NUMERICAL THINKING

1. Hannah collected 567 flowers, she gave to her friends 232 flowers. How many flowers are left?

a. 235
b. 334
c. 335
d. 435

567
-232
_____

2. Charlie has 457 toy cars, his father bought him 242 more toy cars. How many toy cars are there altogether?

a. 597
b. 599
c. 697
d. 699

457
+ 242
_____

3. Choose the operation that represents the following picture

a. 4x4
b. 9x4
c. 4x9
d. 9x9

4. There are two boxes with six oranges. How many oranges are there altogether?

a. 12
b. 14
c. 24
d. 30



5. There are 3 boxes with apples. Each box has six apples. How many apples are there altogether?

a. 15
b. 18
c. 20
d. 22

6. There are 5 boxes. Each box has 5 dogs. How many dogs are there altogether?

a. 25
b. 23
c. 20
d. 18

7. What is the addition that represents the following operation?

5x7

a. 5+5+5+5+5
b. 5+5+5+5+5+5
c. 7+7+7+7+7+7+7
d. 7+7+7+7+7

LIVEWORKSHEETS

VARIATIONAL THINKING

8. Some students answer questions about their preferences about dinosaurs. According with the bar graph how many students voted for the Triceratops?

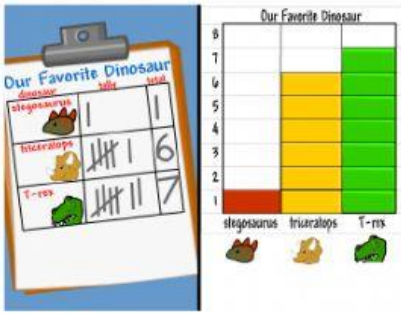

a. 1
b. 6
c. 7
d. 14

9. Look at the following pictograph and choose which sport does our class like the least.

a. soccer
b. baseball
c. football
d. basketball

10. At Summerhill School each student voted for their favorite fruit. According with the bar graph how many students voted for the grapes?

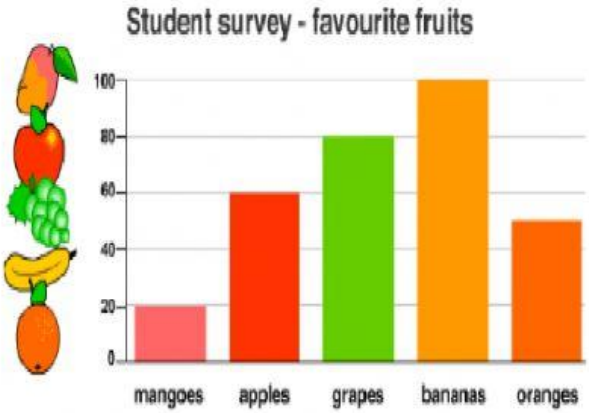

a. 100
b. 80
c. 60
d. 40

LIVEWORKSHEETS