Measuring Weight | kg and g

Measure the weight of each object.

1)

_____ g

2)



_____ kg

3)

_____ g

4)



_____ kg

5)

_____ g

6)

_____ kg

7)

_____ g

8)



_____ kg

9)

_____ g

LIVEWORKSHEETS