DAV HIGH SCHOOL, NAGARJUNASAGAR

CLASS: 8 **SUB: BIOLOGY**

- The cells in a match stick and cork are ( )

  a. Living b. dead

- The cells of onion are transparent, to see them clearly we should use ( )

  a. Acid b. stain c. water d. glycerin

- The outer covering which gives rigidity to the plant cell is ( )

  a. Cell membrane b. cytoplasm c. nucleus d. cell wall

- Plasma membrane is present in both plant cell and animal cell. ( )

  a. True b. False

- A tree and human being are examples of _____ human beings ( )

  a. Unicellular b. multicellular

- Identify:

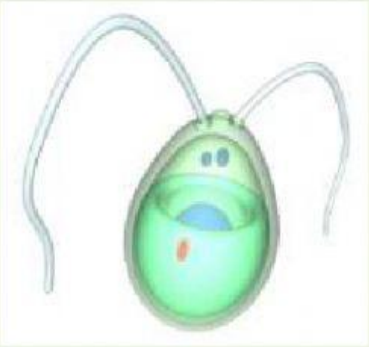

- Identify the parts:

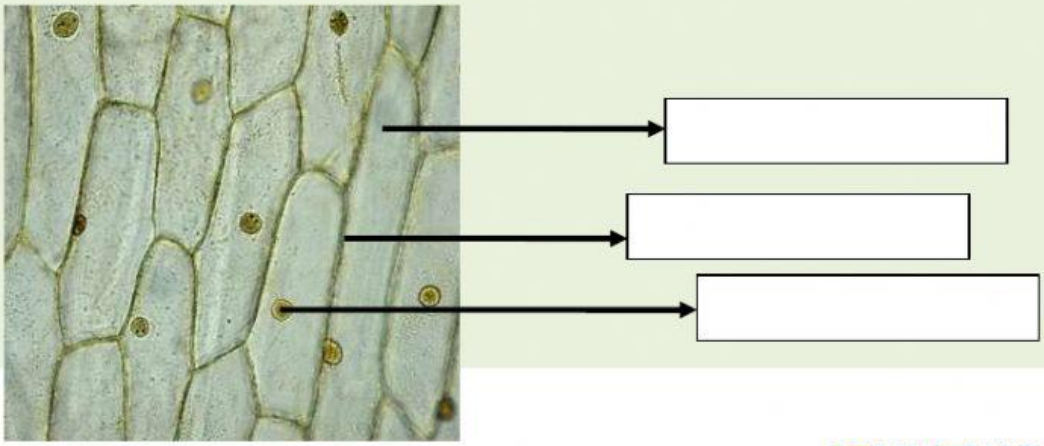

LIVEWORKSHEETS

- This gives a shape to the cell and selectively allows substances ( ) to pass through it, in and out of the cell.
  a. Cell membrane b. cell wall c. nucleus d. cytoplasm

- The longest cell is ( )
  a. Bone cell b. blood cell c. muscle cell d. nerve cell

- The organism with no definite shape ( )
  a. Chlamydomonas b. Paramoecium c. Amoeba d. None

- The cells in elephant are larger than in human being ( )
  a. True b. False

- All living organisms are made up of _____.

- Drag and drop the parts:

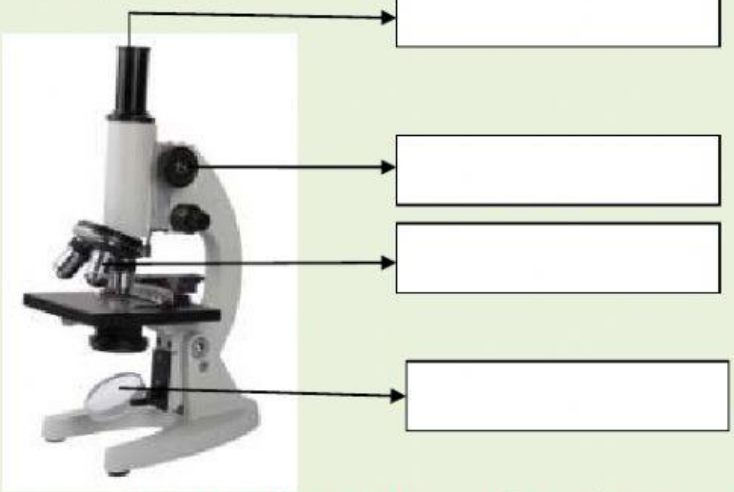

Mirror Coarse adjustment Eye piece Objective lens

- This is used to prevent drying of specimen while preparing the temporary mount ( )

  a. Safranin b. methylene blue c. glycerin d. glass slide

- 1mm = _____ microns or micrometers.

LIVEWORKSHEETS