Окръжност и ъгли

1зад.Плъзнете и пуснете верния отговор:

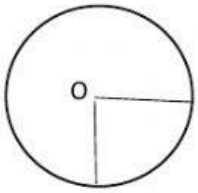

Ъгъл O е

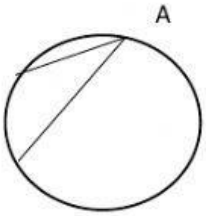

Ъгъл A е

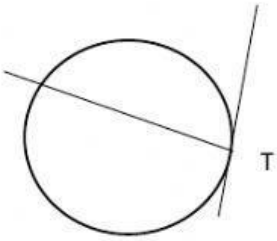

Ъгъл T е

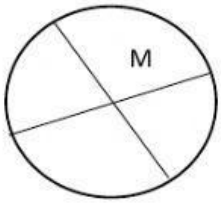

Ъгъл M е

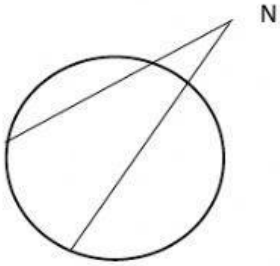

Ъгъл N е

Вписан	Периферен	Ъгъл с връх външна точка
Централен	Ъгъл с връх вътрешна точка	

LIVEWORKSHEETS

2зад. Попълнете:

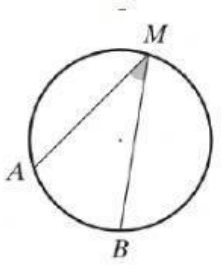

Ако $\widehat{AB} = 100°$

То ъгъл AMB е ……..°

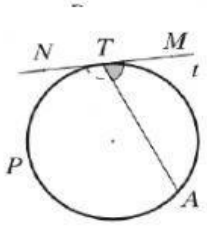

Ако ъгъл ATM е 40°

То $\widehat{AT}$ е .....°

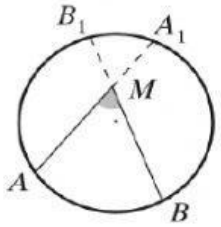

Ако $\widehat{AB} = 120°$, $\widehat{A_1B_1} = 30°$

То ъгъл AMB е .....°

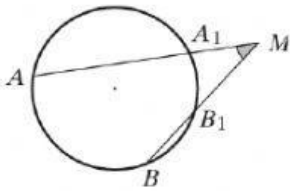

Ако $\widehat{AB} = 120°$, ъгъл AMB = 20°

То $\widehat{A_1B_1}$ = ……°

LIVEWORKSHEETS