7.0 KOORDINAT

7.1.1 JARAK DUA TITIK PADA SATAH CARTESAN

JOM CUBA 7.1

1. Tentukan jarak di antara dua titik pada satah Cartes di bawah.

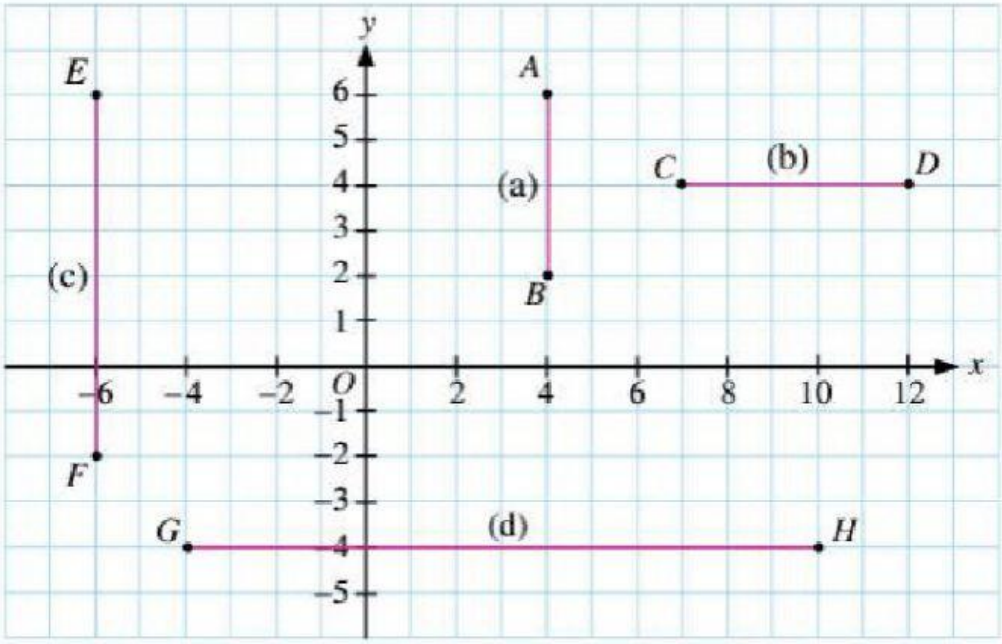

(a)	JARAK AB	unit
(b)	Jarak CD	unit
(c)	Jarak EF	unit
(d)	Jarak GH	Unit

LIVEWORKSHEETS

HITUNG JARAK AB

(b)

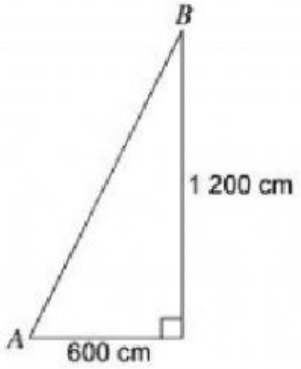

$AB^2 = \square^2 + \square^2$

$AB^2 = 1200^2 + 600^2$

$AB^2 = \square$

$\sqrt{AB} = \sqrt{\square}$

AB = $\square$

c)

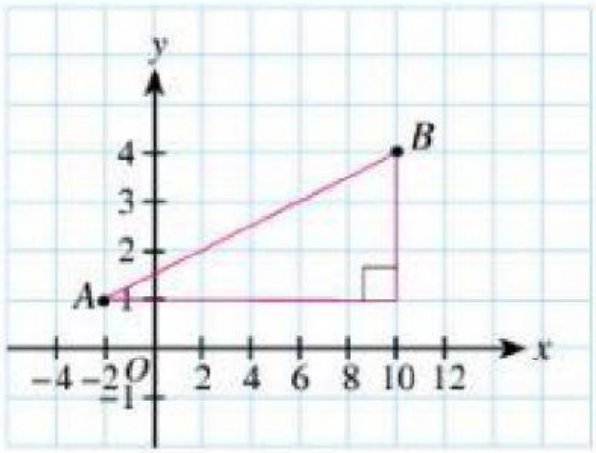

$AB^2 = {}^2 + {}^2$

$AB^2 = \square + \square$

$AB^2 = \square$

$\sqrt{AB} = \sqrt{}$

AB = $\square$

LIVEWORKSHEETS