Name _____

Date _____

Year Group _____

Find the area of the following figures (1-4) if each square is

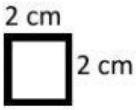

1.

Answer = _____ cm^2

2.

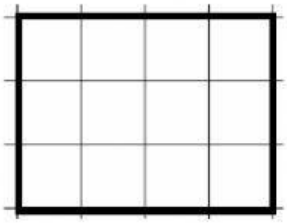

Answer = _____ cm^2

3.

Answer = _____ cm^2

4.

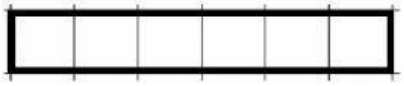

Answer = _____ cm^2

Find the area of the following figures (5-8) if each square is

5.



Answer = _____ cm^2

6.



Answer = _____ cm^2

7.

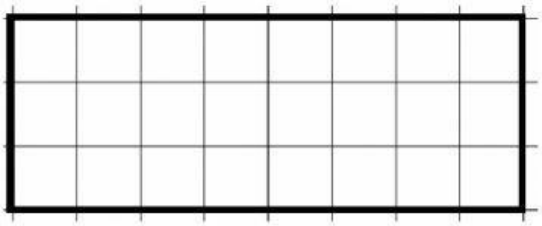

Answer = _____ cm^2

8.

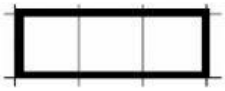

Answer = _____ cm^2

LIVEWORKSHEETS