Name _____ Date _____

Year Group _____

Find the area of the following figures

1.

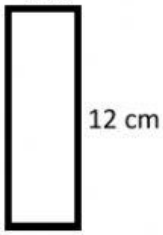

Answer = _____ cm^2

2.

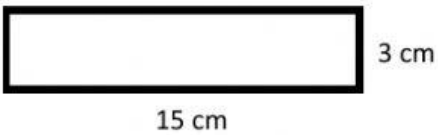

Answer = _____ cm^2

3.

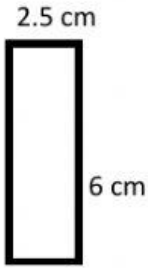

Answer = _____ cm^2

4.

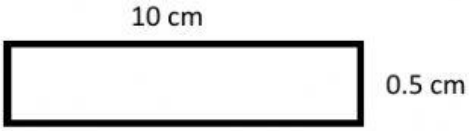

Answer = _____ cm^2

5.

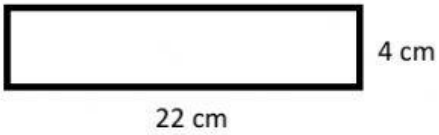

Answer = _____ cm^2

6.

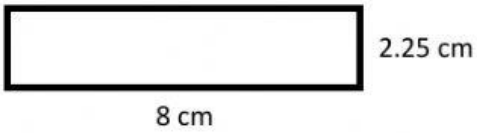

Answer = _____ cm^2

7.

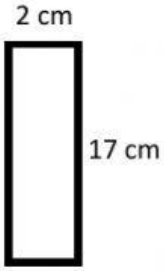

Answer = _____ cm^2

8.

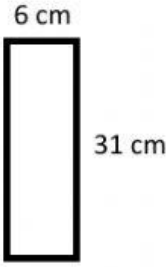

Answer = _____ cm^2

LIVEWORKSHEETS