Nama: _____ kelas :_____

Namakan bahagian tubuh haiwan di bawah.

Kaki selaput renang	kepala	sesungut	sisik	kaki
	sayap	sirip	ekor	





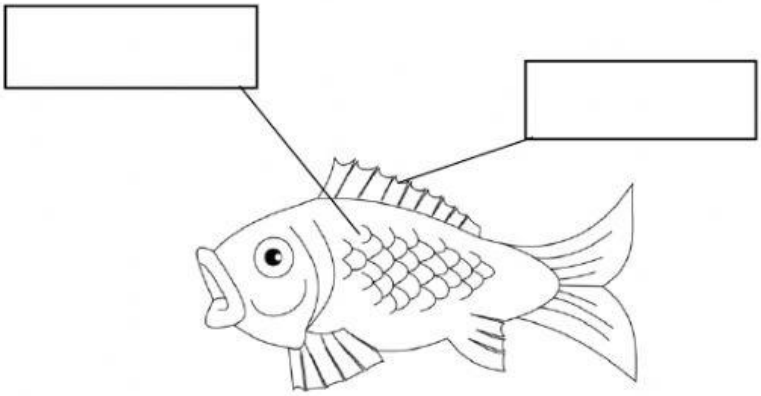

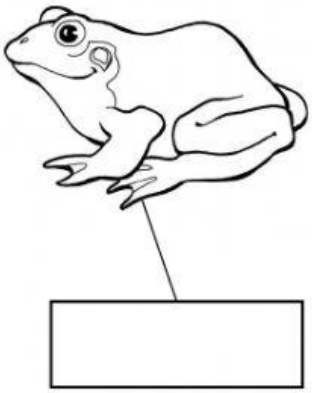

LIVEWORKSHEETS