เศษส่วน

คำชี้แจง: จงโยงเส้นจับคู่ข้อที่เป็นเศษส่วนที่มีค่าเท่ากัน

1. 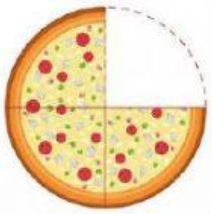

2. 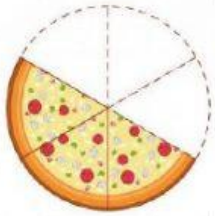

3. 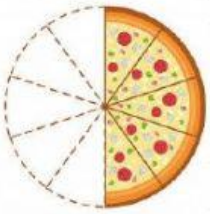

4. 

5. 

ก. $\frac{5}{10}$

ข. $\frac{3}{4}$

ค. $\frac{1}{2}$

ง. $\frac{4}{7}$

จ. $\frac{3}{6}$

LIVEWORKSHEETS