THE AZAPA VALLEY SCHOOL
SOCIAL SCIENCE

English Department
Third Grade A – B
Miss Francisca Calderón V. – Miss María Paz Collado R.

SOCIAL SCIENCE REMEDIAL QUIZ #2

Name: _____ **Date:** _____

Grade: _____ **Total Score:** _____ / 12 points. **Mark:** _____

Objective: Identify the main parallels and meridians of the Earth. Recognize the different ways of representing the planet Earth.

I. Write the name of the parallels, according to the picture. (__/3 pts)

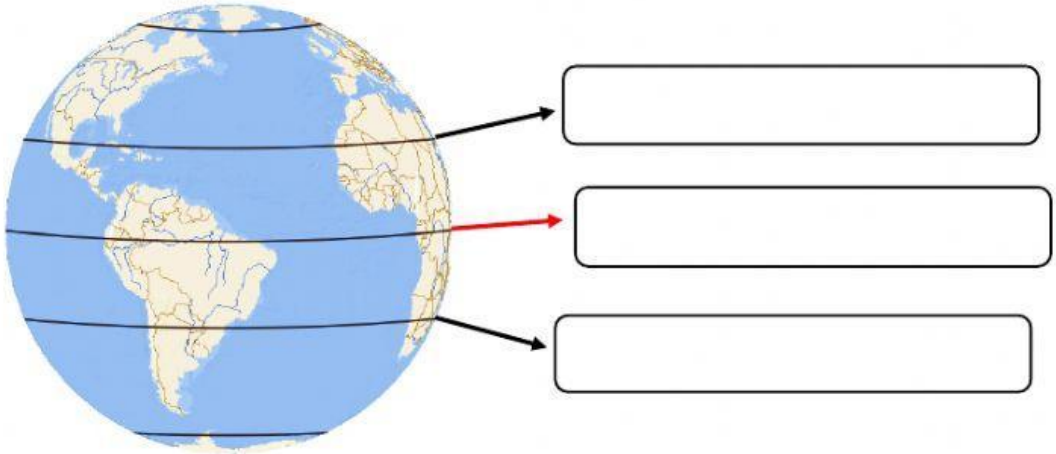

II. Look at the box and write the correct concept according to its meaning. (__/4 pts)

Continents	*Globe*	*Greenwich*	*Map*	*Oceans*	*Equator*	*Planisphere*	*Grid*

1. _____: Large masses of water that cover the Earth's surface.

2. _____: Imaginary line that divides the Earth into the Northern Hemisphere and the Southern Hemisphere.

3. _____: Combination of columns and rows on a plan.

4. _____: Representation of the Earth's Surface that preserves the planet spherical shape.

LIVEWORKSHEETS

III. Circle the correct option. (___/5 pts)

Map of America

1. What type of map is this?

a) Economic map

b) Historical map

c) Political map

d) Physical map

2. What continental features does the map show?

a) Population

b) Relief

c) Economy

d) Borders

3. The Prime Meridian divides Earth into two hemispheres:

a) North pole and South pole

b) East and North

c) Eastern and Western

d) Northern and Southern

Representation of Earth

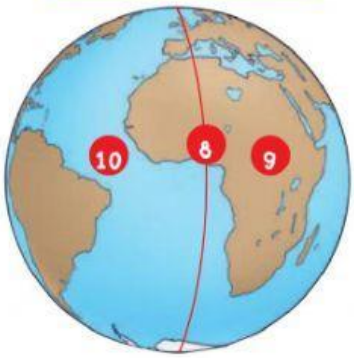

4. What does the number 8 represent?

a) The Prime parallel

b) The Tropic of Capricorn

c) Equator Meridian

d) Greenwich Meridian

LIVEWORKSHEETS

5. The Equator pass through the following continents:

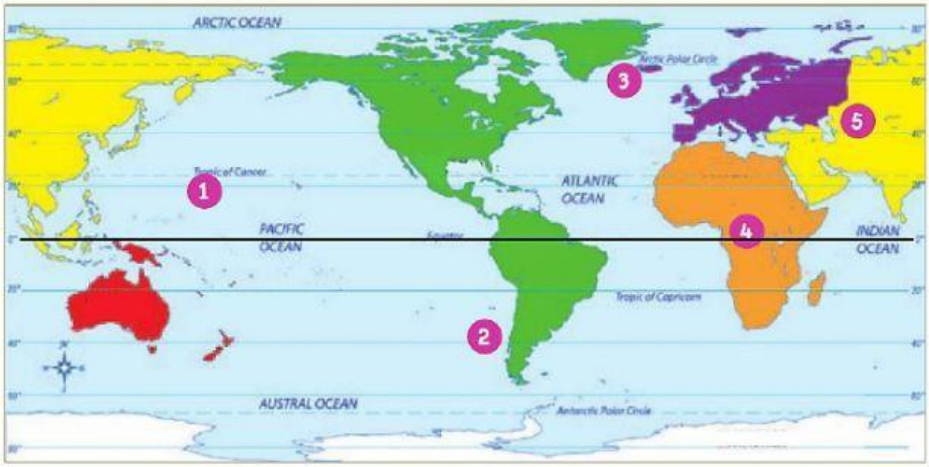

a) Europe, Asia, America and Africa.

b) Oceania, Asia, Africa and America.

c) Oceania, Europe, Antarctica and Asia.

d) Arctic, Oceania, Africa and America.

LIVEWORKSHEETS