NAMA : _____

E. Kira isi padu kotak lohong di bawah.

Kotak lohong	Jumlah kubus 1 cm x 1 cm x 1 cm
1. 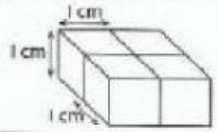	cm^3
2. 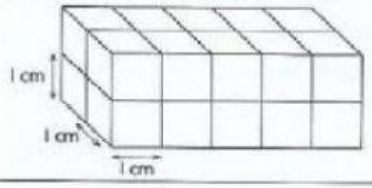	cm^3
3. 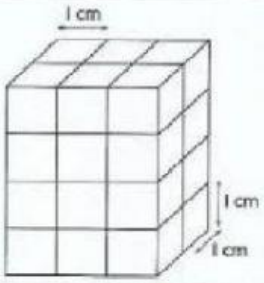	cm^3

A Perhatikan silinder penyukat di bawah. Lorekkan isi padu cecair yang betul. S.P. 12.1(i), (ii)

Contoh

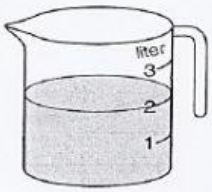

2 mililiter | 2 liter

1

40 mililiter | 20 mililiter

2



100 mililiter | 10 mililiter

3



3 liter | 30 mililiter

4

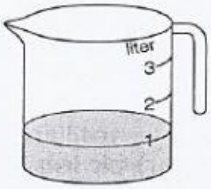

100 mililiter | 1 liter

5

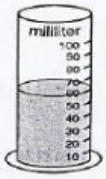

60 mililiter | 6 mililiter

LIVEWORKSHEETS