ใบงาน เรื่องการต่อวงจรอนุกรม ขนาน ผสม

คำสั่ง จงเลือกการต่อวงจรที่ถูกต้องตามภาพที่กำหนดให้

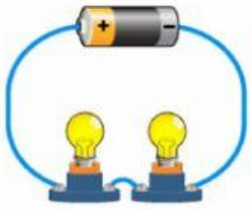	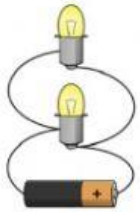
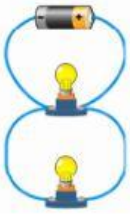	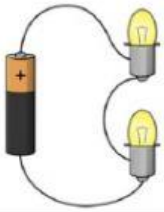
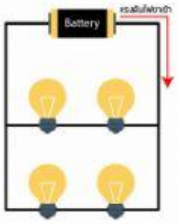	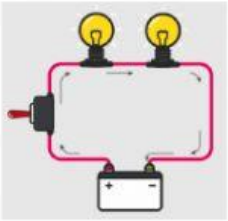
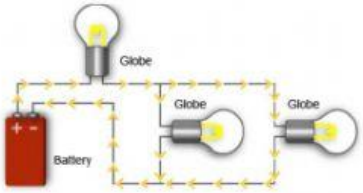	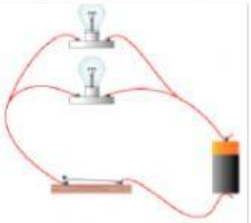
	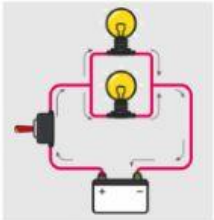

ชื่อ-สกุล:

ระดับชั้น/ห้อง:

LIVEWORKSHEETS