SK KEBAKAT JAYA,
16250 WAKAF BHARU,
KELANTAN

ISIPADU TAHUN 4

NAMA : **KELAS :**

Hitung isipadu kubus dan kuboid di bawah.

216 cm^3	512 cm^3	1 cm^3	30 cm^3	180 cm^3	120 cm^3	32 cm^3	72 cm^3

1.

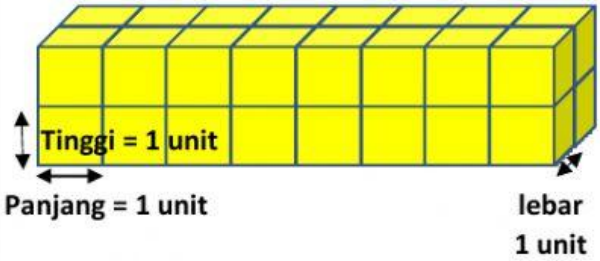

Isipadu satu kubus = ☐

Isipadu seluruh rajah = ☐

2.

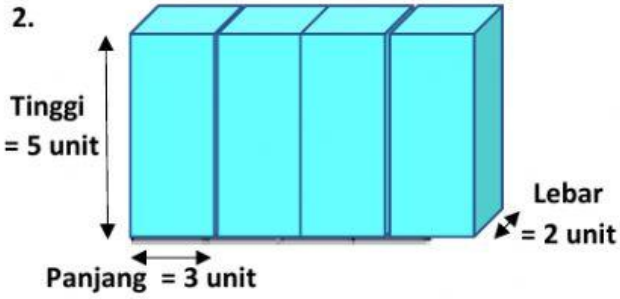

Isipadu satu kuboid = ☐

Isipadu seluruh rajah = ☐

3.

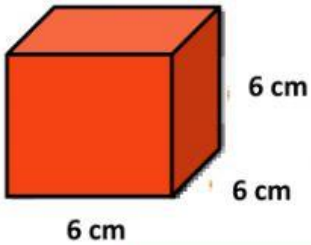

Isipadu seluruh rajah = ☐

4.

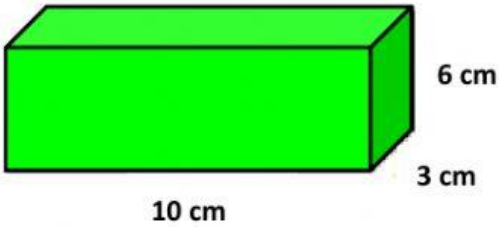

Isipadu seluruh rajah = ☐

5. Kira jumlah isipadu kubus dan kuboid di bawah.

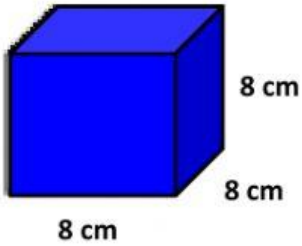

Isipadu seluruh rajah = ☐

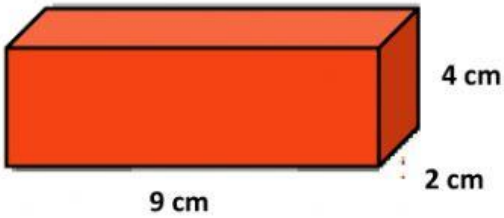

Isipadu seluruh rajah = ☐

Disediakan Oleh Cikgu Wan Asmah

LIVEWORKSHEETS