NAMA: TAHUN:

# UNIT 7 : TENAGA

Tuliskan bentuk tenaga yang betul mengikut gambar rajah.

Contoh :

TENAGA KINETIK





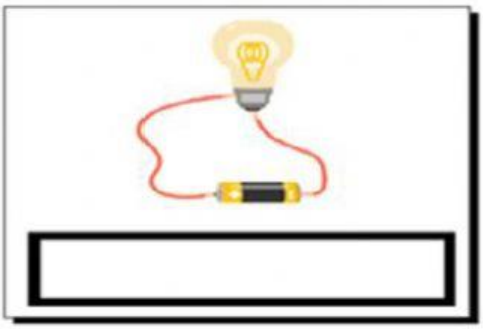





LIVEWORKSHEETS