NAMA:	TINGKATAN:
TAJUK: PERSAMAAN DAN GRAF	STANDARD PEMBELAJARAN: MENENTUKAN BENTUK GRAF BERDASARAKAN PERSAMAAN YANG DIBERI
PADANKAN PERSAMAAN DAN GRAF YANG BETUL	

$y = -x$				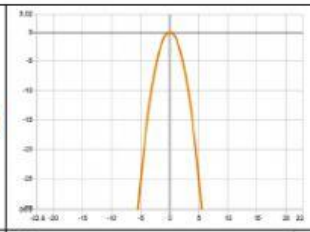
$y = \frac{1}{x}, x \neq 0$				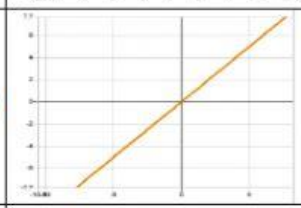
$y = -\frac{1}{x^2}, x \neq 0$				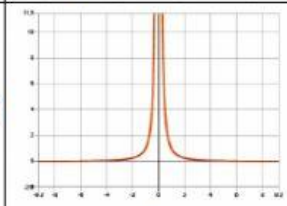
$y = x^2$				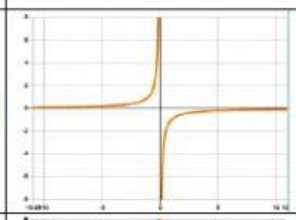
$y = -x^2$				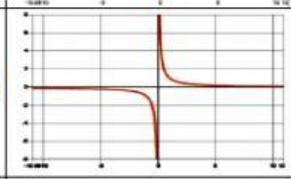
$y = x$				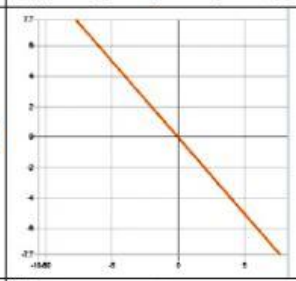
$y = -\frac{1}{x}, x \neq 0$				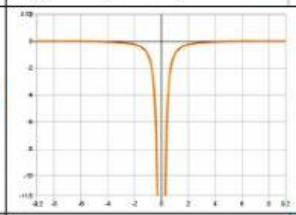
$y = \frac{1}{x^2}, x \neq 0$				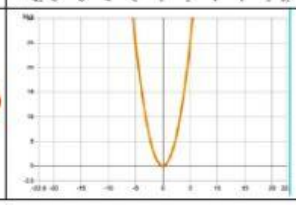

LIVEWORKSHEETS