7.2 Pengairan Arus Elektrik dalam Litar Bersiri dan Litar Selari

1. Padankan komponen elektrik berikut dengan symbol masing-masing

	Komponen elektrik	Simbol
a)	Sel Kering	
b)	Ammeter	
c)	Perintang	
d)	Suis	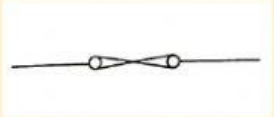
e)	Voltmeter	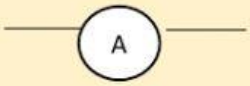
f)	Fius	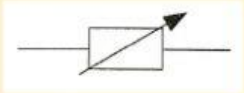
g)	Galvanometer	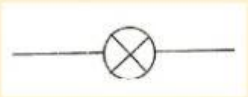
h)	Perintang boleh ubah	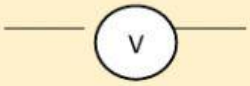
i)	Mentol	

LIVEWORKSHEETS
LIVEWORKSHEETS

Tentukan setiap litar berikut sama ada bersiri atau selari	
	
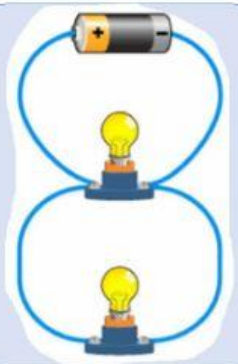	

Berdasarkan litar di bawah, tentukan hubungan di antara setiap perintang sama ada bersiri atau selari	
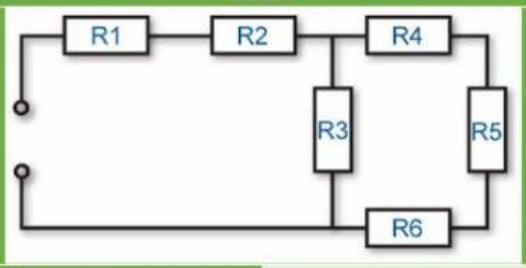	
R1 dan R2	
R1 dan R3	
R1 dan R4	
R1 dan R5	
R1 dan R6	
R2 dan R3	
R2 dan R4	
R2 dan R5	
R2 dan R6	
R3 dan R4	
R3 dan R5	
R3 dan R6	
R4 dan R5	
R4 dan R6	
R5 dan R6	

LIVEWORKSHEETS