UNIDAD EDUCATIVA BENJAMIN FRANKLIN
MONTHLY EVALUATION – 1st TERM – EXAM

Subject: Science **Teacher:** Ing. Oshims. Stanley

Course: 9th grade

PART A: Plant Cells

1. Fill in the space provided with the right answers

a. What is a cell
_____?

b. Mention the two types of cells by structure and an example for each

I. _____

II. _____

c. Cells without nucleus are known as _____

d. Cells with nucleus are known as _____

e. What is the name of the scientist that discovered cells _____?

2. write **T** if the statement is true or write **F** if it is false

____ Multicellular organisms have organs formed by millions of cells

____ This cell is the first level of biological organization

____ Unicellular organisms are made up of just one organ

____ Multicellular being have cells tissues, organs and body system that make up an make up an Organism

____ Unicellular organisms will always be formed by one single cell

LIVEWORKSHEETS

2. Complete the diagram below with words in the box.

stomach	human	Living cells	digestive system	tissue

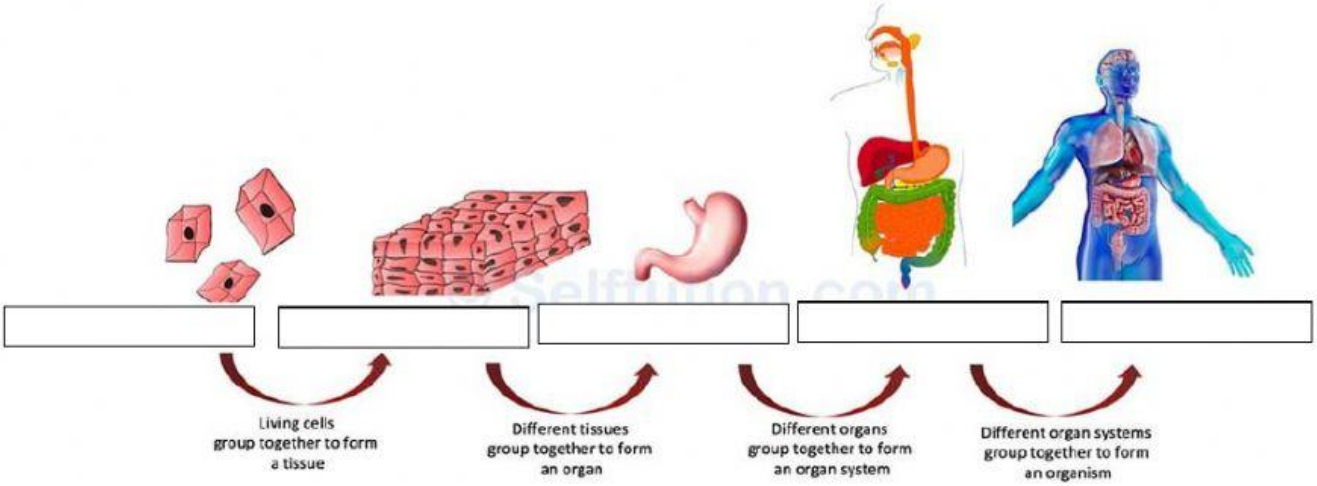

PART B: Tissues

a. What are tissues

_____

b. Mention four types of tissue

I. _____

II. _____

III. _____

IV. _____

c. Write two differences between plant tissues and animal tissues in the table below.

Plant tissues	Animal tissues

LIVEWORKSHEETS

PART C: Organ Systems

a. Identify the following organ system.

Human Organ System

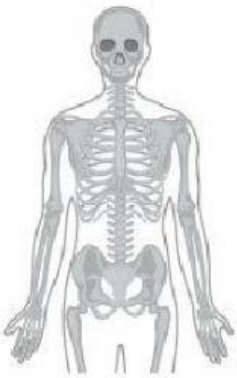

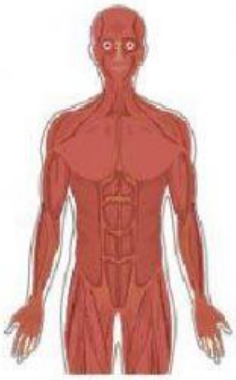

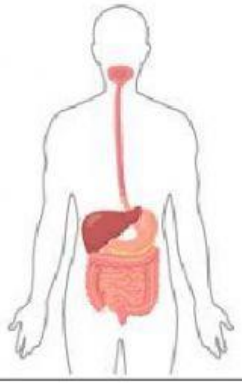

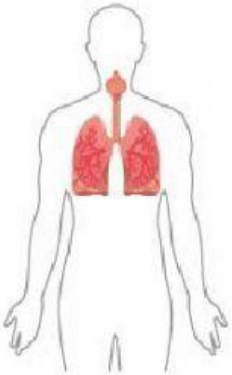

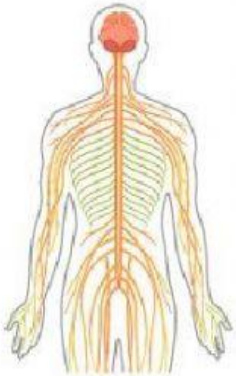

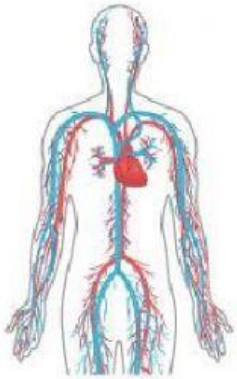

LIVEWORKSHEETS

b. Write four functions of skeletal System

I. _____

II. _____

III. _____

IV. _____

LIVEWORKSHEETS