MATH PRO

Name: _____

Subtraction within 20 : Lesson 1

Write the subtraction stories.

1)



12 – 2 = 10

2)



☐ – ☐ = ☐

3)



☐ – ☐ = ☐

4)



☐ – ☐ = ☐

5)



☐ – ☐ = ☐

6)

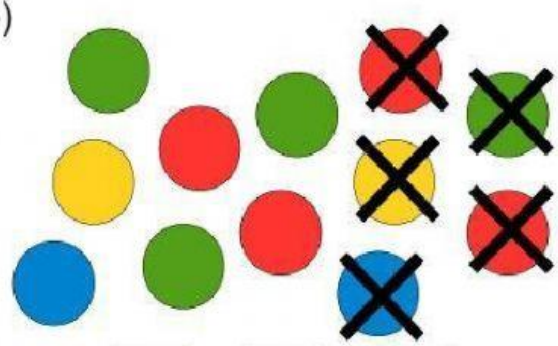

☐ – ☐ = ☐

LIVEWORKSHEETS

Fill the missing part of subtraction number sentences



___ - 1 = ___

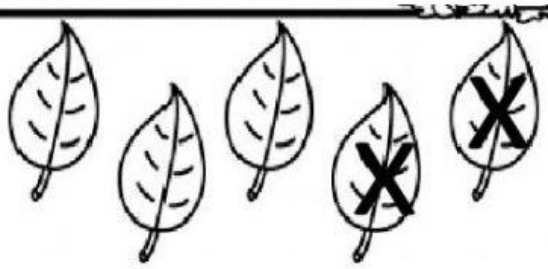

___ - 2 = ___



___ - 3 = ___



___ - 2 = ___



___ - 3 = ___



___ - 1 = ___



___ - 1 = ___

___ - 2 = ___

LIVEWORKSHEETS

addition sentences

3 - 1 = 2



___ - ___ = ___



___ - ___ = ___



___ - ___ = ___

___ - ___ = ___



___ - ___ = ___

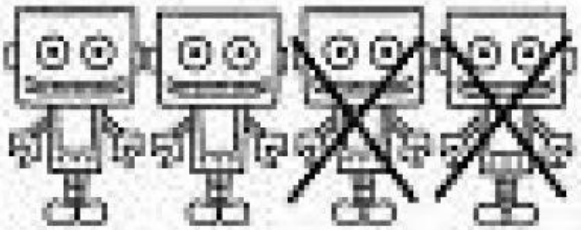

___ - ___ = ___

___ - ___ = ___

This was: Easy Just Right Hard
(Circle one)

LIVEWORKSHEETS