Tajuk: Luas Permukaan 3D
Tahun 6
Disediakan oleh:
Cikgu Norizatul Asma (SK Segari, Lumut Perak)

A. Hitung luas permukaan kawasan berlorek bagi rajah di bawah.

1.

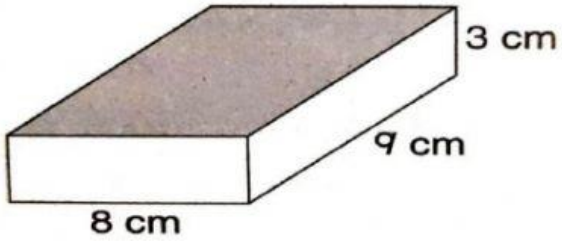

Luas permukaan: ____ cm^2

2.

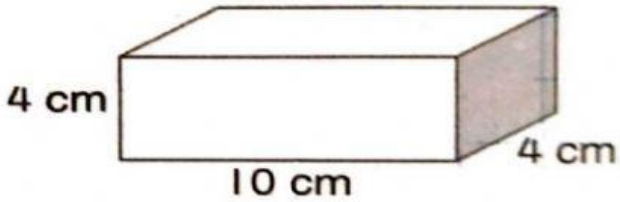

Luas permukaan: ____ cm^2

3.

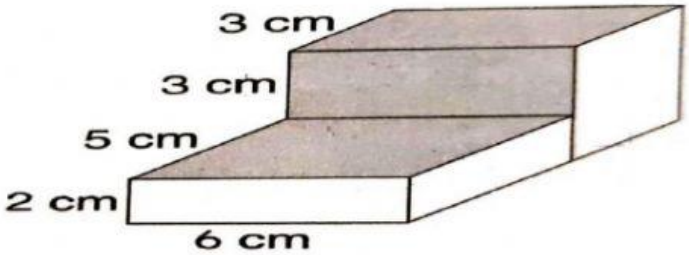

Luas permukaan: ____ cm^2

LIVEWORKSHEETS

4. Rajah 1 merupakan gabungan dua bentuk kuboid.

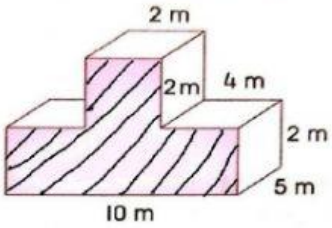

Luas permukaan: $\boxed{}$ m^2

5. Rajah 2 merupakan gabungan dua kuboid.

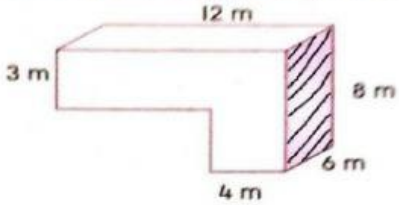

Luas permukaan: $\boxed{}$ m^2

6. Rajah 3 merupakan gabungan dua kuboid.

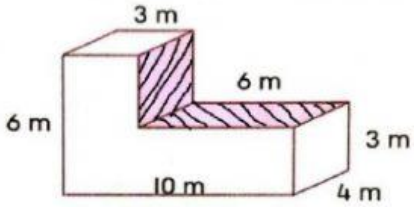

Rajah 3

Luas permukaan: $\boxed{}$ m^2

LIVEWORKSHEETS