Nama :

Kelas :

Arahan : Tuliskan nilai nombor pada setiap gambar pecahan di bawah berdasarkan audio yang didengar.

SATU PER DUA



$\frac{\square}{2}$

SATU PER EMPAT

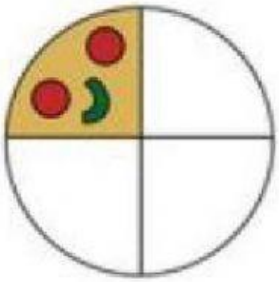

$\frac{\square}{4}$

TIGA PER EMPAT

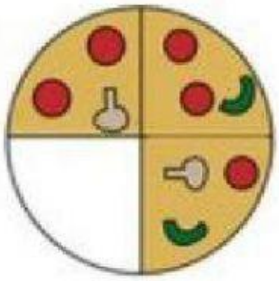

$\frac{\square}{4}$

DUA PER TIGA

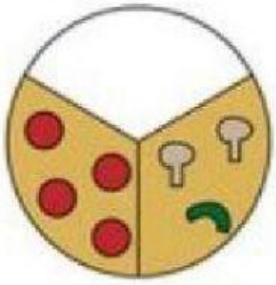

$\frac{\square}{3}$

SATU PER TIGA

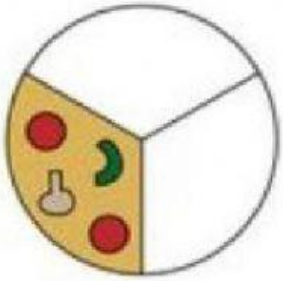

$\frac{\square}{3}$

SATU PER DUA



$\frac{\square}{\square}$

LIVEWORKSHEETS