Hari:..... Tarikh:.....

Nama:.....

Menulis dan menyatakan ayat matematik dengan simbol (-) dan (=).



__ - __ = __

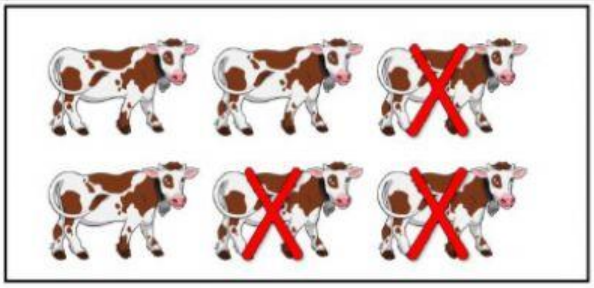

__ - __ = __



__ - __ = __

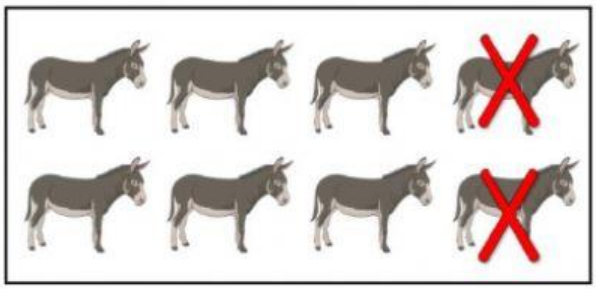

__ - __ = __

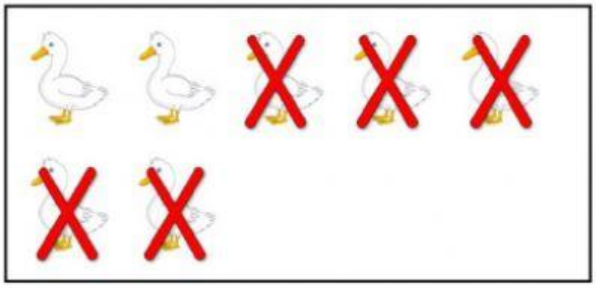

__ - __ = __



__ - __ = __



__ - __ = __



__ - __ = __

Disediakan Oleh: Cikgu Hzman
LIVEWORKSHEETS