Mudahnya Matematik

[Konsep darab - Tambah berulang]

Nama: _____

Lengkapkan ayat Matematik berikut:

Contoh:



4	+	4	+	4	=	12

3	×	4	=	12

1)



2	+	2	+	2	+	2	+	2	=	

	×		=	

2)



3	+	3	+	3	+	3	=	

	×		=	

3)

	×		=	

LIVEWORKSHEETS

4)

☐ × ☐ = ☐

5)



☐ × ☐ = ☐

6)



☐ × ☐ = ☐

7)



☐ × ☐ = ☐

8)



☐ × ☐ = ☐

LIVEWORKSHEETS

Lengkapkan ayat matematik berikut.

1.

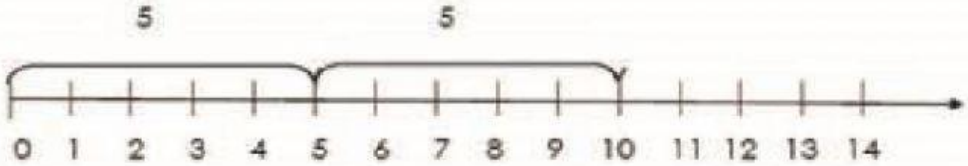

☐ X ☐ = ☐

2.

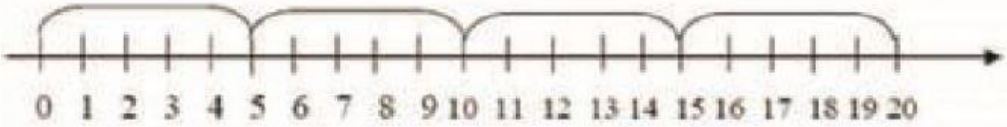

☐ X ☐ = ☐

3.

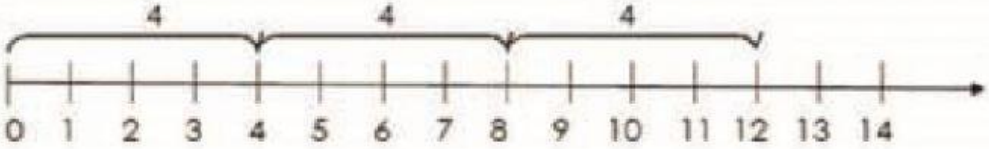

☐ X ☐ = ☐

4.

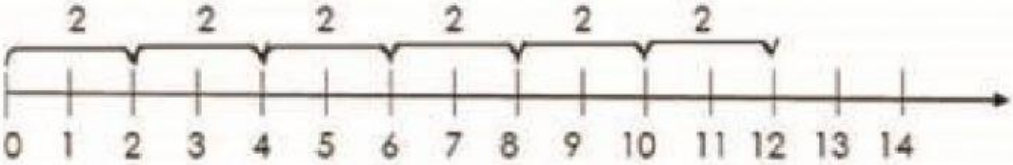

☐ X ☐ = ☐

LIVEWORKSHEETS

1.

Ada [2] kumpulan [2] gula-gula.

2 + 2 + 2 = 6

[ ] x 2 = 6

2.

Ada [2] kumpulan [3] titik biru.

3 + 3 = 6

[ ] x 3 = 6

[ ] x 2 = [ ] x 3

3.

Ada [ ] kumpulan [3] botol air.

3 + 3 + 3 + 3 = [ ]

[ ] x 3 = [ ]

4.



Ada [ ] kumpulan [2] gula-gula.

2 + 2 + 2 + 2 + 2 = [ ]

[ ] x 2 = [ ]

LIVEWORKSHEETS