Mathematics Year 1

Recognise Addition

A. **Fill in the blanks.**

a 3 and 2 make ☐.

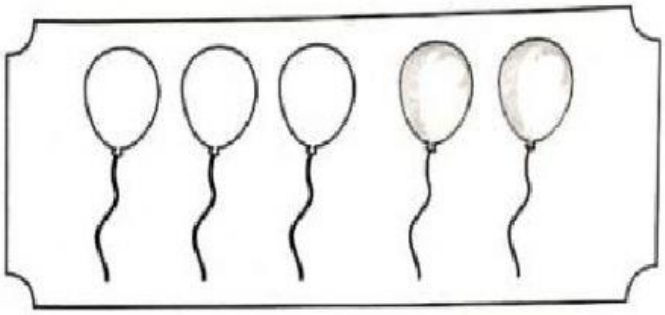

b 3 add 3 is ☐.

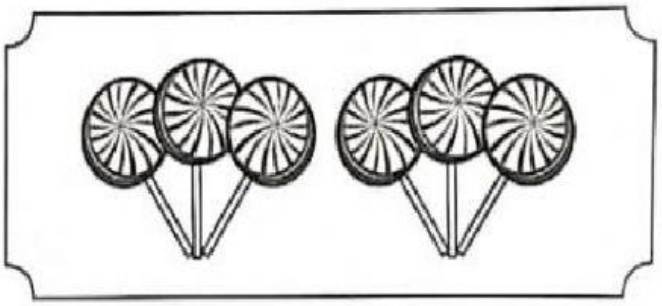

c The sum of 5 and 4 is ☐.



d 1 more than 6 is ☐.



e There are ☐ deers altogether.



LIVEWORKSHEETS

B. Choose the correct answer

a

There is 1 and 1 .

| Balance | Total | is 2.

b



There are 3 big balloons and 3 small balloons. There are 6 balloons

| balance | altogether | .

c

3 girls are playing at the playground. 1 boy is joining them. There are 4 children

| left | altogether | .

d

There are 2 rings on the cone.
Johan puts another 3 rings.
Now, the | difference | total | is 5 rings.

e

There are 8 toys in the box.
Mia | adds | removes | 4 toys to make it a total of 12.

LIVEWORKSHEETS