FICHA DE TRABAJO

Tema: Movimiento a lo Largo de una Línea Recta

Instrucciones: Analiza cada uno de los siguientes ejercicios y da una respuesta acertada en cada caso

1. **En los siguientes casos halla el módulo y dirección de la fuerza resultante.**

a) 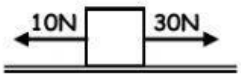

F_R = _____ ( )

b) 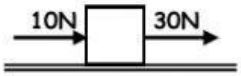

F_R = _____ ( )

c) 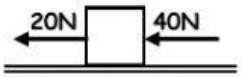

F_R = _____ ( )

d) 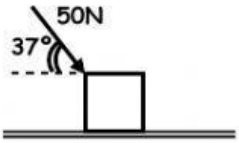

F_R = _____ ( )

e) 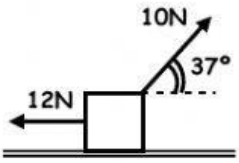

F_R = _____ ( )

f) 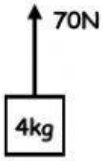

F_R = _____ ( )

2. En los siguientes casos hallar el módulo y dirección de la fuerza resultante.

a) 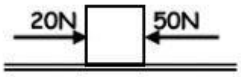

F_R = _____ ( )

b) 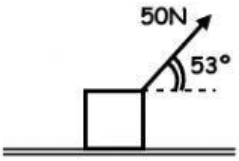

F_R = _____ ( )

Prof. Rosa Nelly Ayaucán García

LIVEWORKSHEETS