MATEMÁTICA

Centena , dezena e unidade

OBSERVE A REPRESENTAÇÃO COM O MATERIAL DOURADO
E FAÇA COMO NO EXEMPLO.

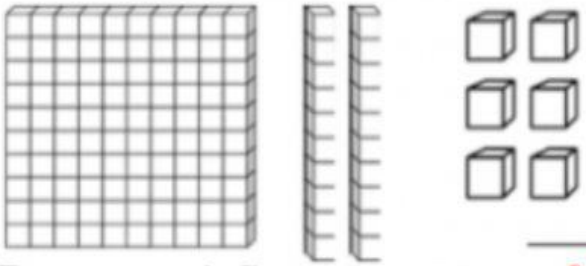

Decomposição: 100 + 20 + 6

Leitura: CENTO E VINTE E SEIS

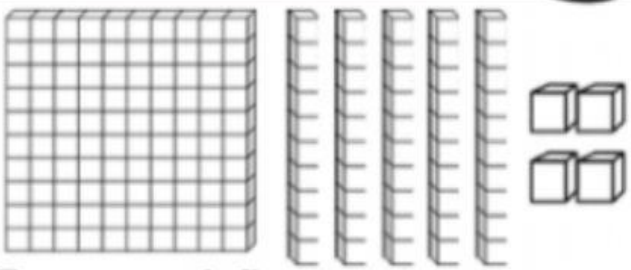

Decomposição: ____ + ____ + ____

Leitura: _____

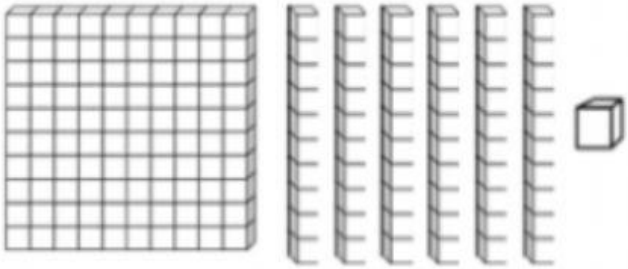

Decomposição: ____ + ____ + ____

Leitura: _____

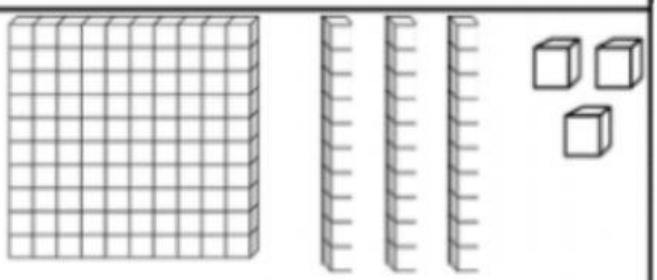

Decomposição: ____ + ____ + ____

Leitura: _____

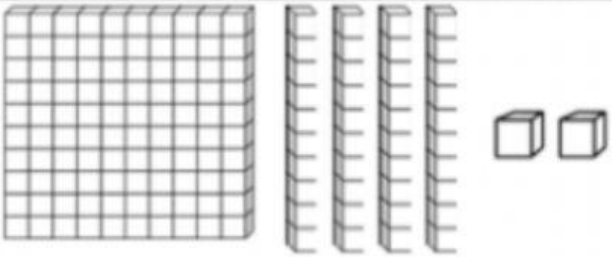

Decomposição: ____ + ____ + ____

Leitura: _____

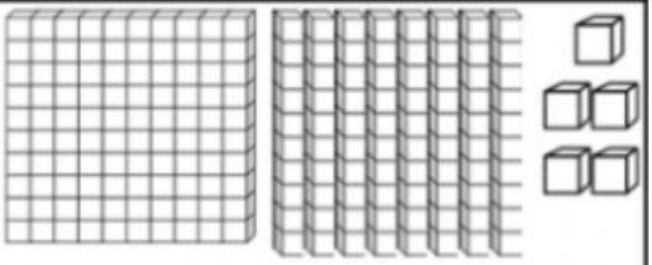

Decomposição: ____ + ____ + ____

Leitura: _____

LIVEWORKSHEETS