ESCOLA:_____

ALUNO(A):_____ DATA:_____/_____/_____

PROFESSORA:_____

LEIA,OBSERVE A IMAGEM .

A centena

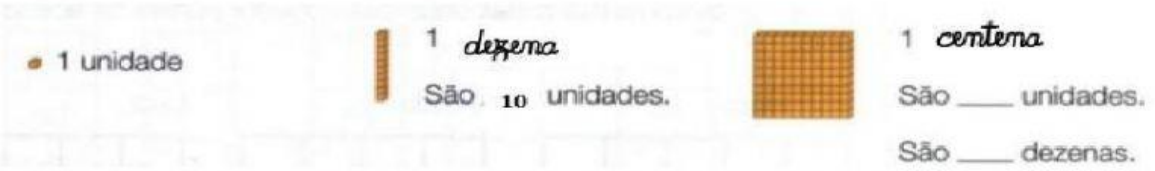

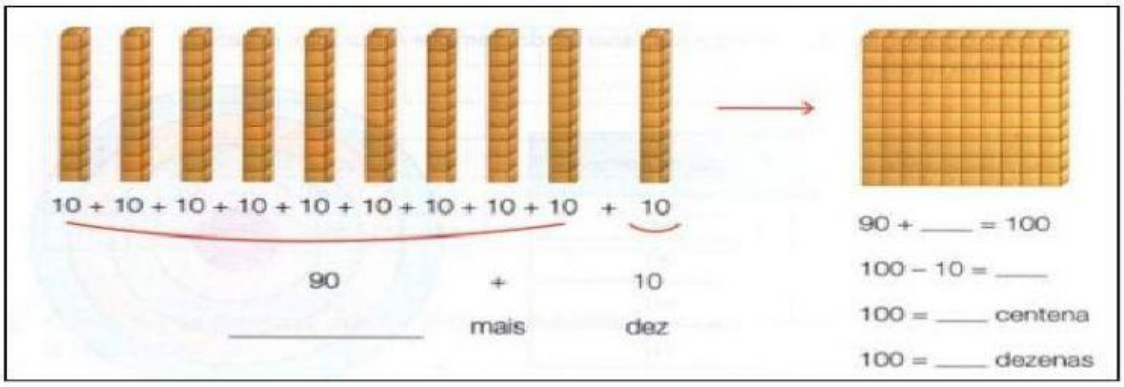

CENTENA	DEZENA	UNIDADE
		

1 centena = 10 dezenas = 100 unidades

LIVEWORKSHEETS

1) COMPLETE OS ESPAÇOS COM O VALOR REPRESENTADO PELO MATERIAL DOURADO.

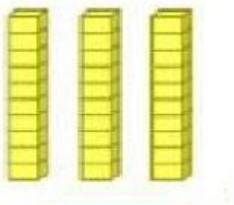



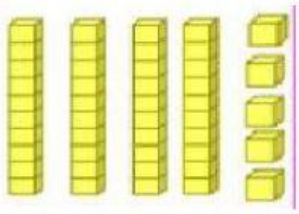



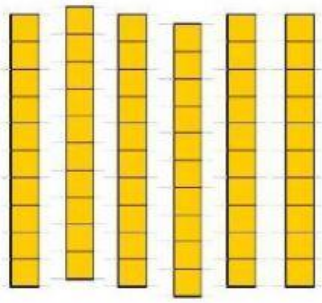

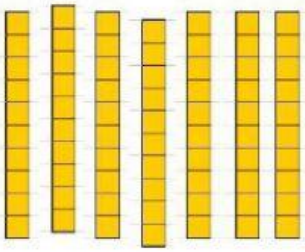

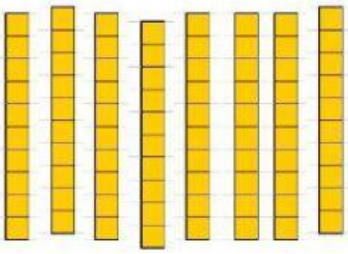

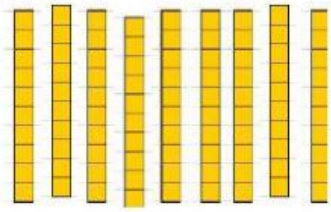



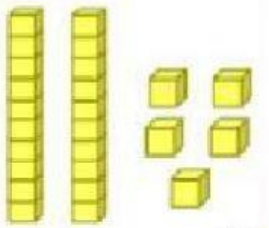

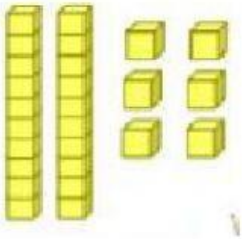

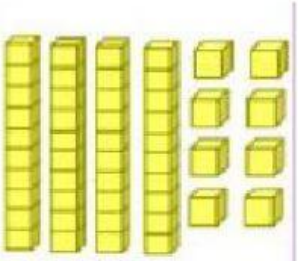

LIVEWORKSHEETS

A FESTA JUNINA É UMA TRADICIONAL FESTIVIDADE POPULAR QUE ACONTECE DURANTE O MÊS DE JUNHO.

2) COMPLETE AS PALAVRAS:

 _ _ _ _ _ U	 _ _ _ _ E _ _ _	 _ I _ _ _ _
 _ _ _ _ _	 _ _ _ Ã _	 _ _ _ _ _ _ _ A _
 _ _ _ _ _ _ _	 _ _ _ _	 _ _ N _ _ _ _

3) NO SEU CADERNO ESCREVA: O CABEÇALHO, PULE UMA LINHA, ESCREVA <u>ATIVIDADE</u>, PULE OUTRA LINHA E ESCREVA:

1) ESCREVA DE O ATÉ 100:

LIVEWORKSHEETS