# Telling Time

Write the time inside each clock below









| | | |
|---|---|---|
| A<br>10 : 55 | B<br>4 : 40 | C<br>9 : 45 |
| D<br>12 : 25 | E<br>10 : 15 | F<br>8 : 50 |
| G<br>9 : 10 | H<br>4 : 00 | I<br>11 : 20 |

LIVEWORKSHEETS