Susun percambahan hipogeal biji benih mengikut aturan yang betul

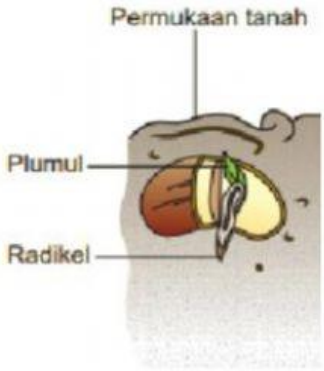

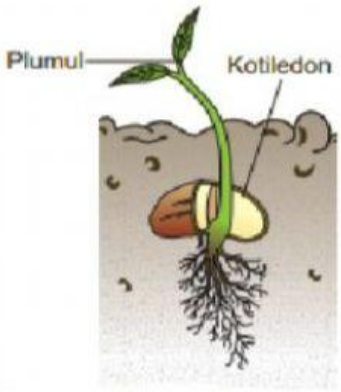



Lengkapkan takrifan berikut

Kotiledon tumbuhan _____ tanah semasa percambahan disebut sebagai percambahan **hipogeal**

LIVEWORKSHEETS