Anglo American School
Math
Partial test
I Semester

Observations:

Assessment	
*Understands and applies basic properties related to numbers. **(Part 1)**	
*Uses adequate procedures to solve basic operations. **(Part 2)**	
*Understands and applies the basic properties related to measurement. **(Part 3)**	
*Uses a variety of strategies to solve story problems. **(Part 4)**	

LIVEWORKSHEETS

Part 1. <u>RELATED TO NUMBERS</u>

A. Write the number corresponding to the picture.

1. Standard Form: _____

2. Expanded Form: _____

B. Solve it.

728

1 more: _____

10 more: _____

100 less: _____

LIVEWORKSHEETS

Part 2. BASIC OPERATIONS

A. Rewrite the numbers in the value box.
Solve the following operations.
Regroup if needed.

287 + 152=

H	T	O

194 + 28 =

H	T	O

63 - 29 =

H	T	O

45 – 37 =

H	T	O

LIVEWORKSHEETS

Part 3. MEASUREMENT

A. Measure the length of each line and complete the missing information.

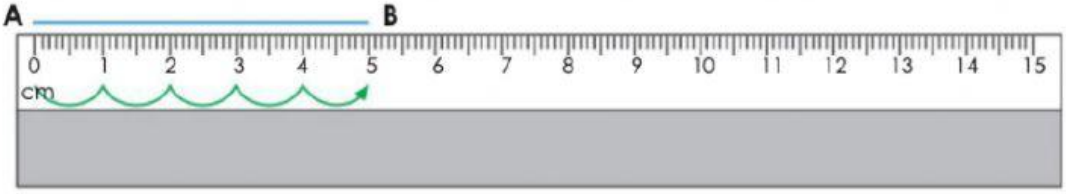

1. Line AB is _____ centimeters long.

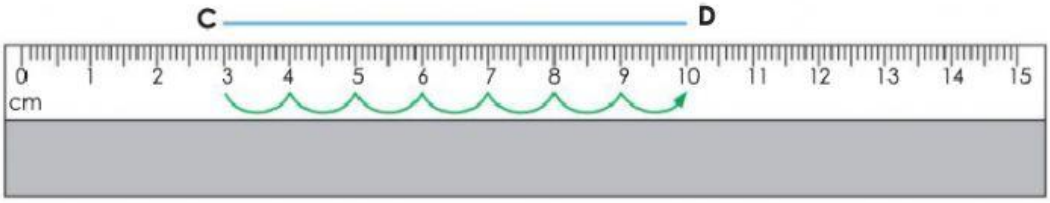

2. Line CD is _____ centimeters long.

B. Choose an appropriate unit of measure.
Fill in the blanks with centimeters, meters, grams or kilograms.

The length of the book is 28 _____ long.

The length of the door is 2 _____ long.

The mass of the girl is 35 _____.

LIVEWORKSHEETS

Part 4. PROBLEM SOLVING

A. Read carefully and follow the steps studied in class.
B. Complete the chart with the correct information.

- Lucy wants to make dolls. She buys 60 meters of cloth. After making many beautiful dolls, she has 8 meters of cloth left. How many meters of cloth does Lucy use?

Data:

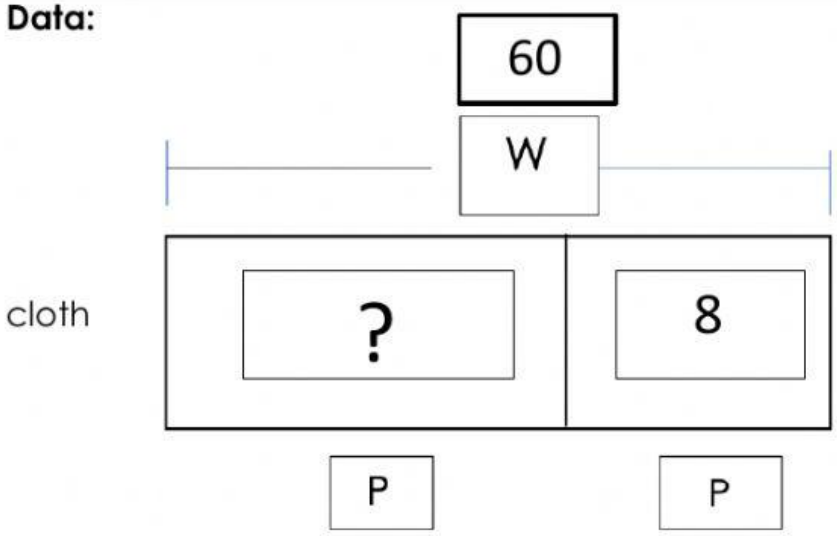

part + part = whole

whole – part = part

_____ ◯ _____ = ?

Operation:

H	T	O

Answer:
Lucy used _____ meters of cloth.

LIVEWORKSHEETS

- Sebastián walked from his house to the supermarket 350 meters and then from the supermarket to the library 550 meters.
  How far did he walk in total?

Data:

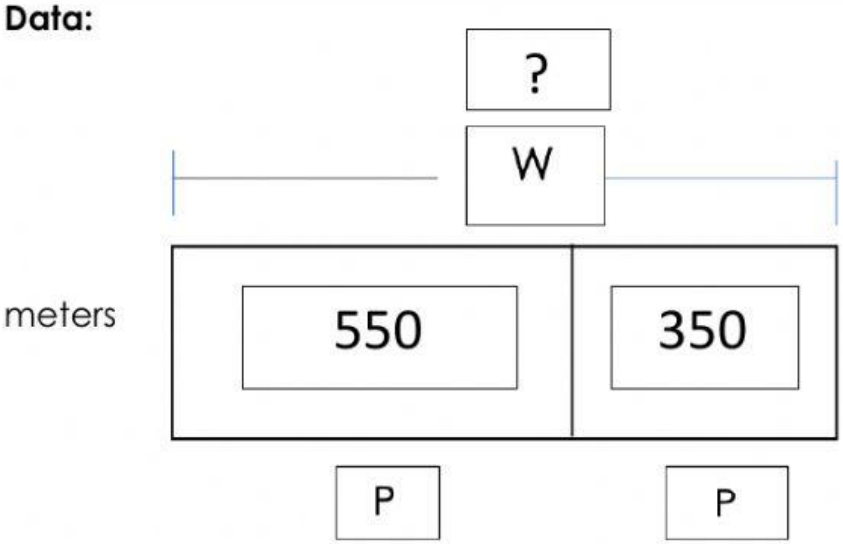

part + part = whole

whole – part = part

_____ ◯ _____ = ?

Operation:

H	T	O

Answer:
He walked _____ meters in total.

LIVEWORKSHEETS