Matematik Tahun 3 - Pecahan

1

Nyatakan pecahan bagi belon:

a) merah ___ b) biru ___ c) kuning ___ d) ungu ___

2 Pilih dan sebut pecahan setara bagi pecahan yang diberi.

a $\frac{2}{3}$ — $\frac{4}{6}$ $\frac{1}{6}$

b $\frac{4}{5}$ — $\frac{8}{5}$ $\frac{8}{10}$

c $\frac{3}{4}$ — $\frac{4}{8}$ $\frac{6}{8}$

d $\frac{6}{9}$ — $\frac{2}{3}$ $\frac{3}{2}$

3 Permudahkan.

a $\frac{2}{6} = \frac{2 \div}{6 \div} \frac{\square}{\square} = \frac{\square}{\square}$

b $\frac{4}{8} = \frac{4 \div}{8 \div} \frac{\square}{\square} = \frac{\square}{\square}$

c $\frac{8}{10} = \frac{8 \div}{10 \div} \frac{\square}{\square} = \frac{\square}{\square}$

4 Tulis nombor bercampur dan pecahan tak wajar.

a

b 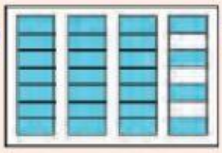

c 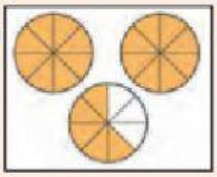

d 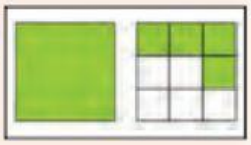

$\square \frac{\square}{\square} = \frac{\square}{\square}$ $\square \frac{\square}{\square} = \frac{\square}{\square}$ $\square \frac{\square}{\square} = \frac{\square}{\square}$ $\square \frac{\square}{\square} = \frac{\square}{\square}$

5 Kelaskan mengikut pecahan tak wajar atau nombor bercampur

$2\frac{1}{4}$ $\frac{6}{6}$ $3\frac{2}{9}$ $\frac{9}{4}$ $1\frac{4}{5}$ $\frac{7}{3}$ $\frac{14}{8}$ $\frac{15}{7}$

pecahan tak wajar	nombor bercampur
☐ ☐ ☐ ☐ ☐	☐ ☐ ☐

LIVEWORKSHEETS