Reinforcement

Mathematics

Name: _____ Class: 1 Date: _____

Q1 Read the number figures and write words of the given numbers.

H	T	O	
1	0	0	
1	2	2	
1	1	1	
	7	5	
	8	8	
	1	3	

LIVEWORKSHEETS

Q2 Recognize and find one, halves and quarters of a number

a) Write fractions for given picture

$\frac{1}{2}$ $\frac{1}{3}$ $\frac{1}{4}$



b) Identify which shape is **one, halve, quarter**

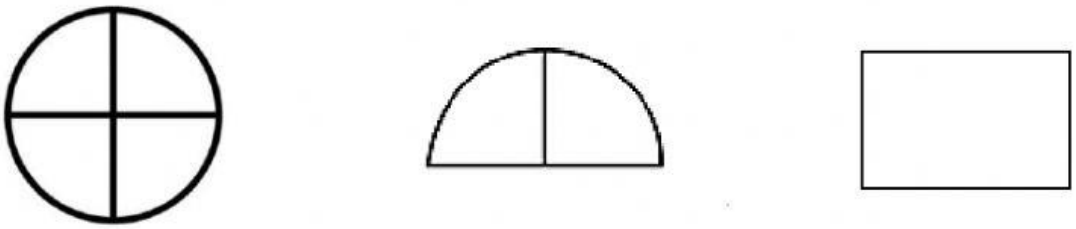

_____ _____ _____

LIVEWORKSHEETS

Q3 Recognize and tells time to the hour and half past in analogue and digital clock.

a) Draw the hands on the analogue clock to match the time.

3:00

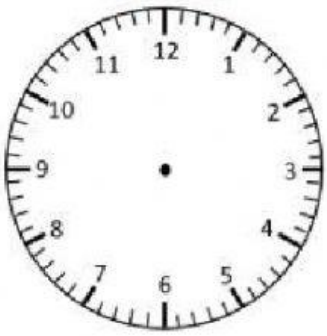

Half past 3

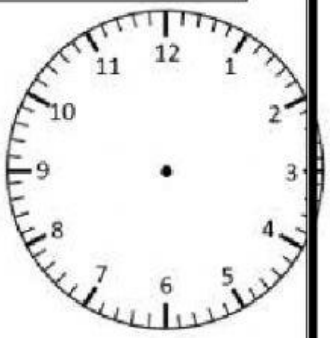

b) Write the time shown on the analogue clocks

_____ _____

LIVEWORKSHEETS

Q 4 Recognize the place value of each digit in a two-digit number.

a) write counting from 70 up to 100

H	T	O		H	T	O		H	T	O
	7	0								

b) Place value into tens and ones

54 = _____tens and _____ones

_____tens and _____ones = _____

LIVEWORKSHEETS

Q5 Add and Subtract with 20

Solve each problem

1+ 10= ☐

3 more than 10 is ☐

10 and 2 makes= ☐

Solve the missing numbers

17 – 5 = ☐

20 - ☐ = 13 ☐

What is 16 – 4?

16 – 4

10 ☐

☐ – 4 = ☐

10 + ☐ = ☐

16 – 4 = ☐

LIVEWORKSHEETS

Q 6 Identify odd and even numbers.

Complete the sentence use odd and even number

(a)

(b)

8 is an _____ number	9 is an _____ number

c) John says that half of an even number is an odd number.

Give an example to show that what he said is not always correct.

_____

_____

Q7 Calculates doubles and halves of numbers up to 20?

What is half of 4 squares? _____

What is half of 10 ? _____

LIVEWORKSHEETS

2. Complete

a) Double of _____ is 2

b) Double of 5 is _____

Q 8. Make number pairs up to 10



c) 1 and 9 makes = ☐

d) 2 and 8 makes = ☐

LIVEWORKSHEETS

Q 9 Subtract double digit numbers vertically

13	20	10
-10	-11	-7

One step word problem

a) Jim has 10 birds

4 birds fly away

How many birds left -------?



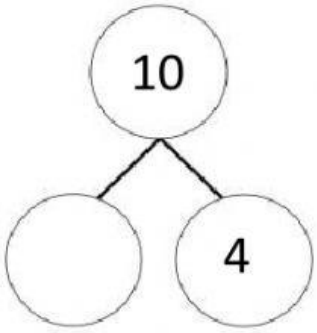

b) Jack buys 12 oranges, He eats 7 oranges.

How many oranges are left_____?

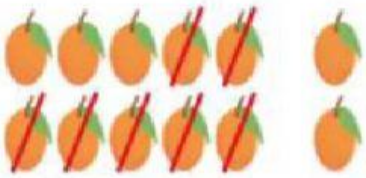

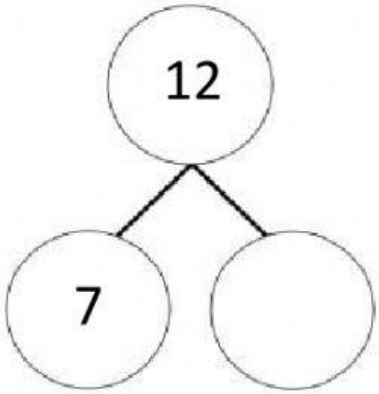

LIVEWORKSHEETS

Q 10. Recognize and exchanges coins of different values

What is the value of coin

=_____cent?

What is the value of the coin

=_____

What is the value of notes?

= _____ Rupee

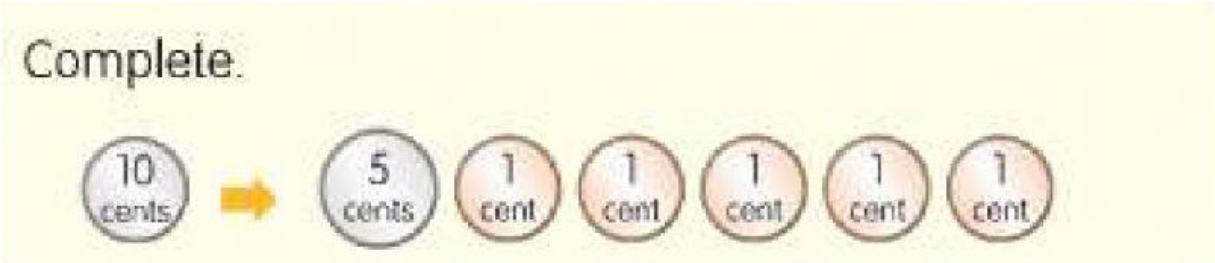

10 cents = _____ 5 cent coins and _____ 1 cent coins

LIVEWORKSHEETS