NAME : _____ 1 SENTHAMIL

Recognise Place Value and Digit Value

Textbook Vol. 1 PP. 25 – 27

A. Fill in the blanks. LS1.6.1

EXAMPLE

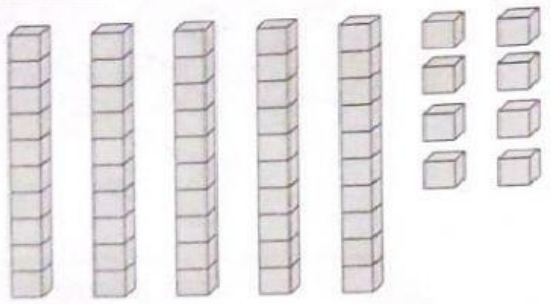

5 tens 8 ones = 58

1.

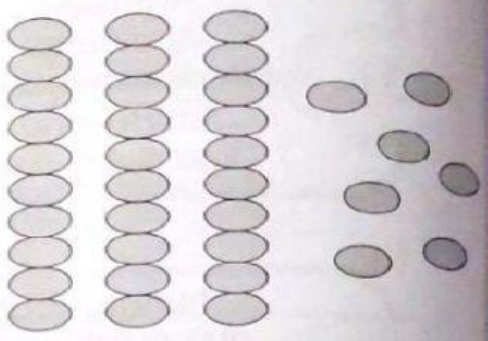

____ tens ____ ones = ____

2.

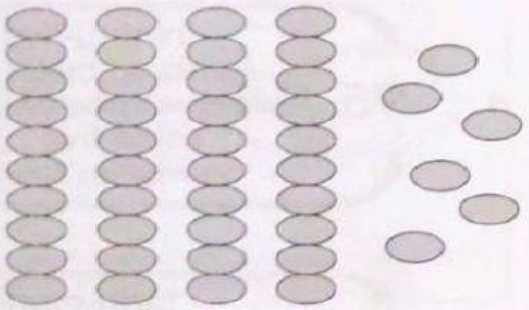

____ tens ____ ones = ____

3.

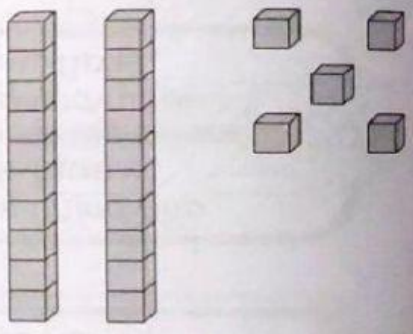

____ tens ____ ones = ____

B. Write the place value and digit value of the underlined digit. LS1.6.1

	Number	Place value	Digit value
1.	7<u>5</u>		
2.	4<u>5</u>		

	Number	Place value	Digit value
3.	9<u>3</u>		
4.	8<u>2</u>		

LIVEWORKSHEETS