KEMAHIRAN 8 :
Operasi Tambah Dalam Lingkungan 18

A. Selesaikan hasil tambah berikut.

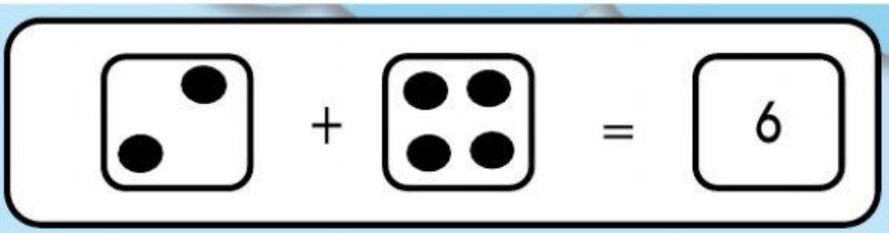

a.

b.

c. 

d. 

CIKGU FARHANA

e. 

LIVEWORKSHEETS

KEMAHIRAN 8 :
Operasi Tambah Dalam Lingkungan 18

B. Selesaikan hasil tambah berikut.

a.	6 + 5 =	11
b.	4 + 8 =	
c.	5 + 4 =	
d.	7 + 6 =	
e.	8 + 7 =	
f.	3 + 5 =	
g.	5 + 2 =	
h.	9 + 9 =	
i.	4 + 4 =	
j.	8 + 9 =	
k.	6 + 5 =	

LIVEWORKSHEETS

KEMAHIRAN 8 :
Operasi Tambah Dalam Lingkungan 18

C. Selesaikan operasi tambah berikut.

8 + 4 = 12

a.

		pu	sa	
			8	
	+		4	
		1	2	

5 + 6 = ___

b.

9 + 5 = ___

c.

6 + 6 = ___

d.

8 + 7 = ___

e.

3 + 7 = ___

f.

LIVEWORKSHEETS