WORKSHEET

Refer to the figure and classify the relationship between each pair of angles as ***alternate interior, consecutive interior, alternate exterior*** or ***corresponding interior angles.***

- 1) $< 3\ and\ < 5$ are

  A) Alternate interior angles
  B) alternate exterior angles
  C) Consecutive interior angles
  D) Corresponding angles

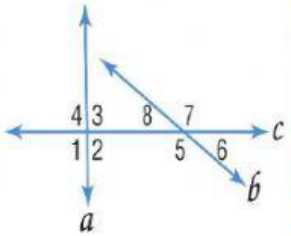

- 2) $< 1\ and\ < 5$ are

  A) Alternate interior angles
  B) Alternate exterior angles
  C) Consecutive interior angles
  D) Corresponding angles

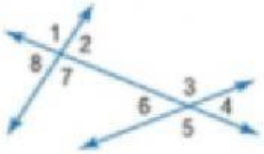

- 3) $< 4\ and\ < 8$ are

  A) Alternate interior angles
  B) Alternate exterior angles
  E) Consecutive interior angles
  F) Corresponding angles

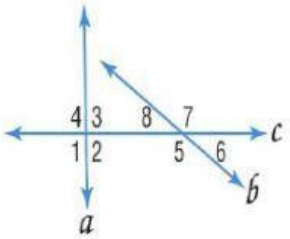

- 4) $< 2\ and\ < 5$ are

  A) Alternate interior angles
  B) Alternate exterior angles
  G) Consecutive interior angles
  H) Corresponding angles

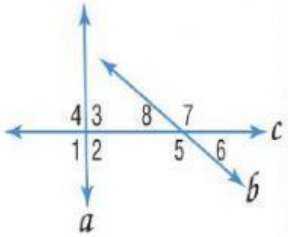

LIVEWORKSHEETS
pageborders.org

LIVEWORKSHEETS