Year 4 Mathematics-Term 3 Week 10 Lesson 4

Topic: Negative Numbers

To count backwards through zero in the context of temperature.

1) Some numbers are missing from these thermometers. Can you label them correctly?

a)

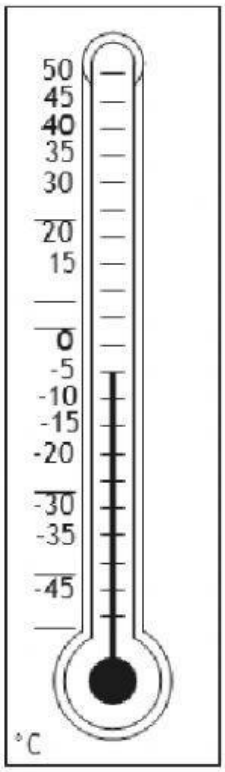

b)

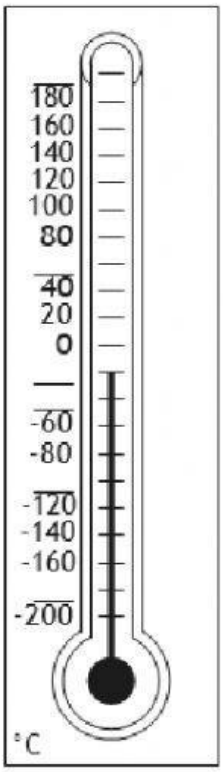

c)

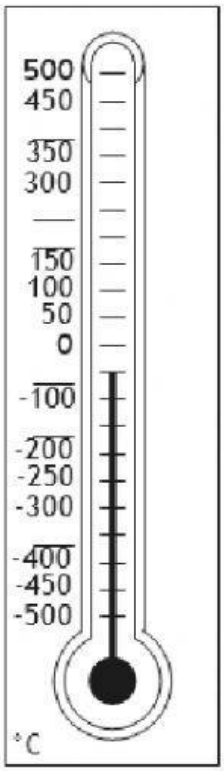

Hot or cold? Write the correct temperature.

a) Which is hotter: -125°C or 150°C?

b) Which is colder: -515°C or -6°C?

c) Which is hotter: 95°C or 0°C?

d) Which is hotter: -12°C or -2°C?

e) Which is colder: 0°C or -12°C?

LIVEWORKSHEETS

On Friday, the temperature was -6°C overnight and -1°C in the daytime. How many degrees Celsius warmer was it in the daytime?

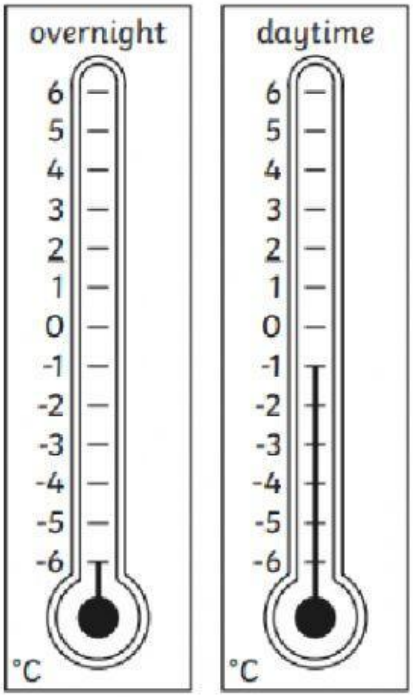

_____

Yesterday, the lowest temperature was -5°C. Today's lowest temperature is 3°C colder. What is today's lowest temperature?

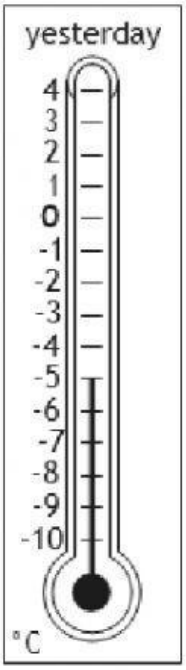

_____

LIVEWORKSHEETS