Anchor Chart - Unit 7

WATER CYCLE

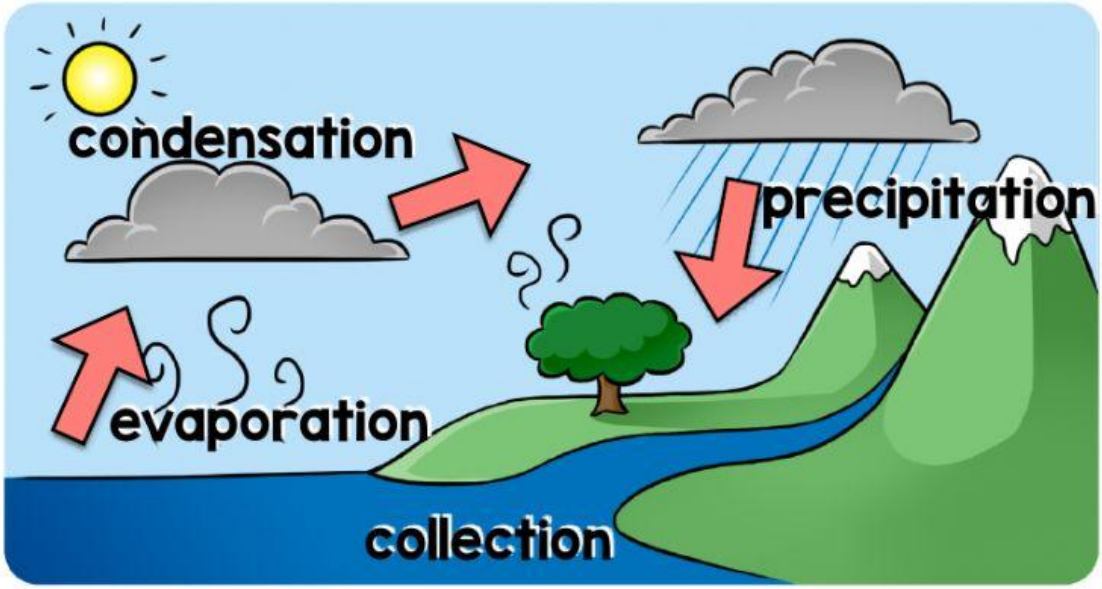

precipitation: water from sky/clouds

collection: water collects on the ground

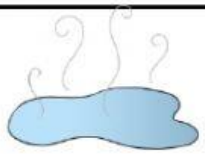

evaporation: water going up by changing into water vapor

condensation: water vapor changes into liquid

Level 3

LIVEWORKSHEETS

Unit 7 Page 8 Name: _____ Date: _____

Read the text and then answer the questions:

Precipitation comes down from the clouds in the form of rain or snow. Water collects on the ground. Water then goes up into the sky as water vapor. You can't see water vapor. The water vapor then turns into liquid water during condensation. Condensation forms clouds. Then the whole process starts again!

1. Where does precipitation come from?

_____

2. Can you see water vapor?

_____

3. How are clouds formed?

_____

Fill in the names for each part of the water cycle:



LIVEWORKSHEETS

Unit 7 Page 9 Name: _____ Date: _____

Fill in the blanks:

Freezing: going from liquid to _____.

Evaporation: going from _____ to gas.

Fill in the blanks using the following words:

cloud	**water vapor**	**ground**	**up**

Water falls from a _____ and collects on the _____ . Then the water evaporates. It goes _____ in the air and turns into _____ .

Circle the correct answer:

water turning to water vapor

◯ evaporation ◯ precipitation ◯ collection

water collects on the ground

◯ condensation ◯ collection ◯ precipitation

water vapor changing into liquid

◯ evaporation ◯ condensation ◯ collection

water falling from the sky

◯ evaporation ◯ precipitation ◯ condensation

LIVEWORKSHEETS

Unit 7 Page 10 Name: _____ Date: _____

Answer the questions:

What is condensation?

_____

_____

What is precipitation?

_____

_____

During evaporation, where does water go?

_____

_____

Match:

collection

evaporation

condensation

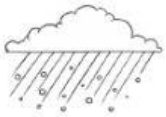

sun

precipitation

evaporation

LIVEWORKSHEETS