Tambah

Berapakah jumlah kesemuanya? Tuliskan nombor yang betul.

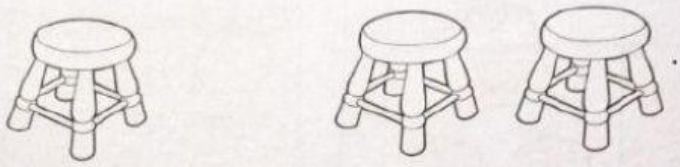

1 + 2 = _____

2 + 3 = _____

3 + 5 = _____



6 + 4 = _____

LIVEWORKSHEETS

Tambah

Berapakah jumlah kesemuanya? Tuliskan nombor yang betul.

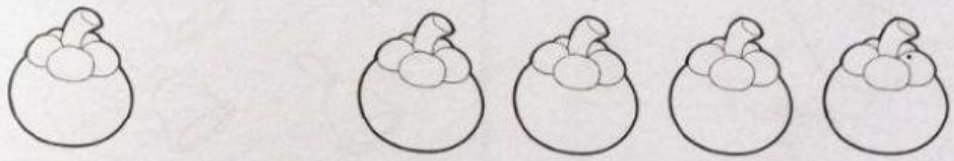

1 + 4 = _____



2 + 2 = _____



7 + 2 = _____

4 + 3 = _____

LIVEWORKSHEETS