Escola/Colégio:	
Disciplina: **QUÍMICA**	Ano/Série:
Estudante:	

1. Dê o nome dos radicais a seguir: (Ligue os pontos)

a) $H_3C-CH(CH_3)-$ •

b) $H_3C-CH_2-CH_2-H_2C-$ •

c) 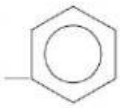 •

d) $H_3C-CH(-)-CH(CH_3)-$ •

e) $H_2C=CH_2-$ •

f) $H_3C-CH(CH_2-)-CH_3$ •

g) 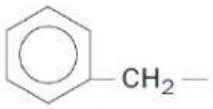 •

h) $H_3C-C(CH_3)_2-$ •

- isopropil
- sec-butil
- vinil
- butil
- fenil
- terc-butil
- isobutil
- benzil

2. Considere o composto hipotético a seguir: (Arraste e solte)

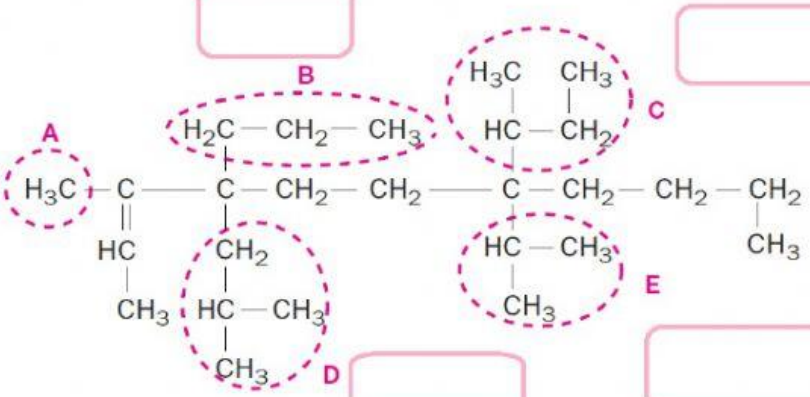

sec-butil

metil

isopropil

isobutil

propil

Dê o nome dos radicais assinalados (**A**, **B**, **C**, **D** e **E**).

LIVEWORKSHEETS