Revision Worksheet: Angles and Turns

1. How many degrees are in a right angle?

2. What letter does a right angle look like?

3. Order these angles from smallest to largest:

straight line 130˚ right angle half a right angle

4. Order these angles from largest to smallest:

120 ˚ 90 ˚ angles on a straight line

5. Look at the picture: is the angle smaller than, greater than or equal to 90 ˚

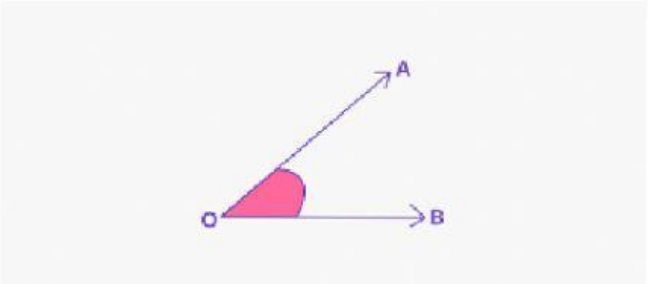

LIVEWORKSHEETS

6. Look at the picture: is the angle smaller than, greater than or equal to 90 °

7. Look at the picture: is the angle smaller than, greater than or equal to 90 °

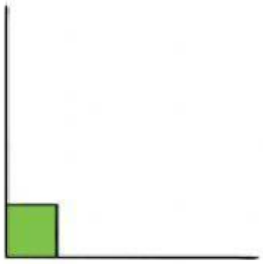

8. Look at the angles below. One of the angles is 50 °. Find the angle that is 50 ° and explain how you can tell.

A.

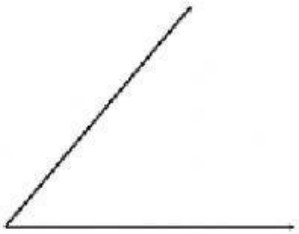

LIVEWORKSHEETS

B.

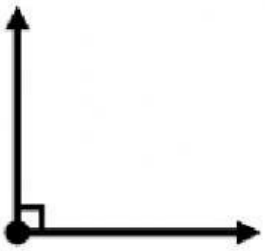

C.

9. What can we use as a right-angle checker?

10. How many degrees are in a quarter turn?

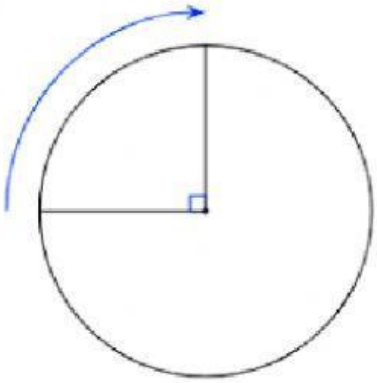

LIVEWORKSHEETS

11. How many degrees are in a half turn?

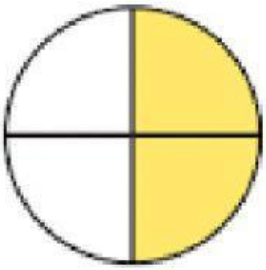

half turn

12. How many degrees in a whole turn?

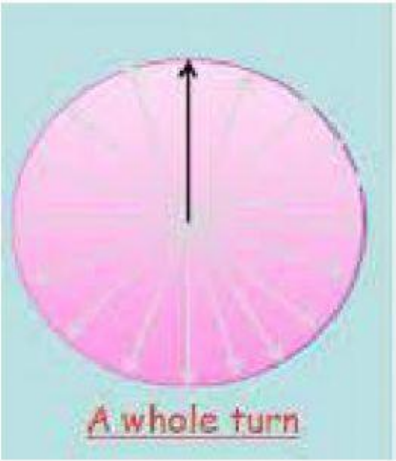

LIVEWORKSHEETS