Exterior Angle Theorem

Solve for the given variable.

1) 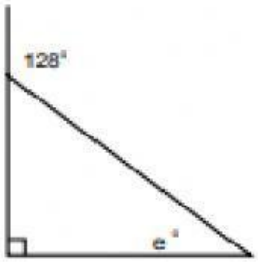

e = ____

2) 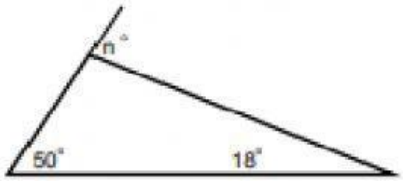

n = ____

3) 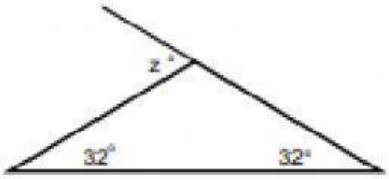

z = ____

4)

h = ____

5)

b = ____

6) 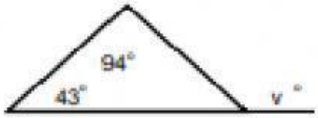

v = ____

7) 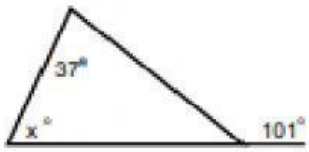

x = ____

8) 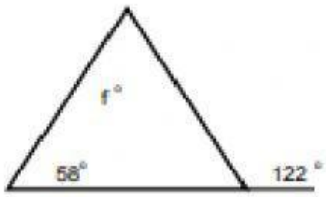

f = ____

LIVEWORKSHEETS