ATIVIDADE AVALIATIVA DE MATEMÁTICA

NOME:

DATA:

PROFESSORA ADRIANA LOPES - 1º ANO - TURMA 102

1 LIGUE A IMAGEM AO SEU NOME.

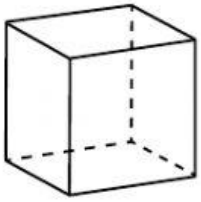

CONE

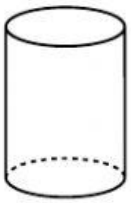

ESFÉRA

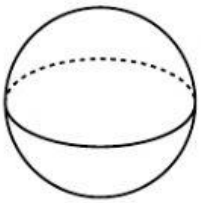

CUBO

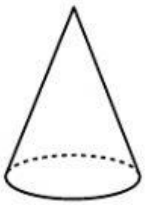

CILINDRO



BLOCO RETÂNGULAR

LIVEWORKSHEETS

2 ESCREVA COMO SE LÊ OS NÚMEROS ABAIXO. DEPOIS LIGUE OS NÚMEROS NAS QUANTIDADES REPRESENTADAS AO LADO.

12



15

18

10

11



19

14



LIVEWORKSHEETS

3 ESCREVA QUANTOS REAIS CADA CRIANÇA TEM.

PAULA

_____ REAIS

LETÍCIA

_____ REAIS

JOÃO

_____ REAIS

BRUNO

_____ REAIS

4 VEJA O PREÇO DE CADA PRODUTO. ARRASTE E COLE OS VALORES REPRESENTADOS PELO DINHEIRO.

R$ 4,00

R$ 11,00

R$ 10,00

LIVEWORKSHEETS

5 RESOLVA AS ADIÇÕES.



2 + 6 =

6 + 4=

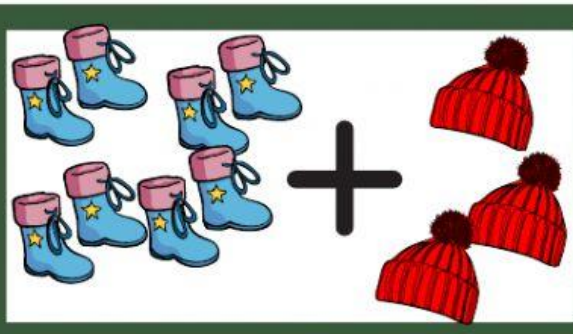

8+ 3 =

5 + 1=



7+ 2=



4 + 4=

AMO VOCÊS!

LIVEWORKSHEETS