ALIŞTIRMALAR

Aşağıda kenar uzunlukları verilen dikdörtgenlerin örnekteki gibi iki farklı şekilde çevre uzunluklarını bulunuz.

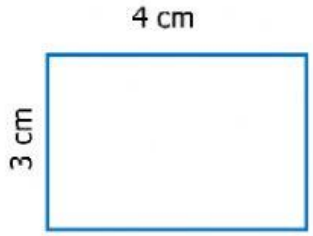

Ç = 4 + 4 + 2 + 2 = 12 cm

veya

4 x 2 = 8 cm

3 x 2 = 6 cm

Ç = 8 + 6 = 14 cm

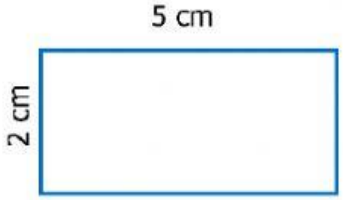

Ç = ...

veya

.....

.....

Ç = ...



Ç = ...

veya

.....

.....

Ç = ...

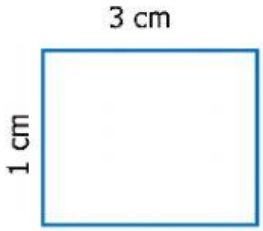

Ç = ...

veya

.....

.....

Ç = ...

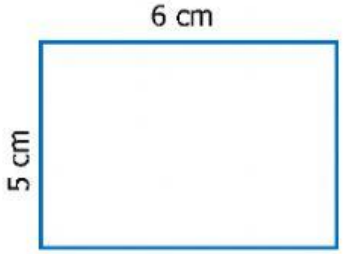

Ç = ...

veya

.....

.....

Ç = ...

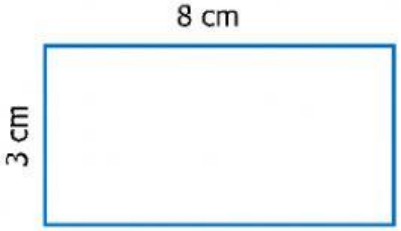

Ç = ...

veya

.....

.....

Ç = ...

Aşağıda çevre uzunlukları verilen dikdörtgenlerin bir kenar uzunluğunu bulunuz.

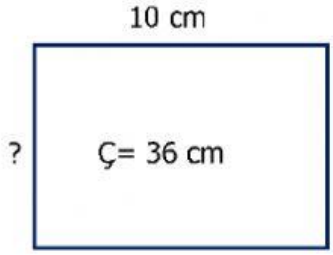

..... x ..... = ...

..... - ..... = ...

..... ÷ ..... = ...

Ç = ... cm

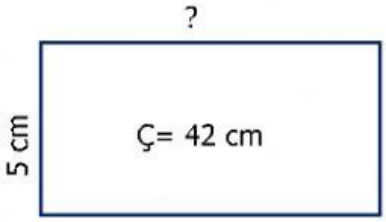

..... x ..... = ...

..... - ..... = ...

..... ÷ ..... = ...

Ç = ... cm

LIVEWORKSHEETS