ESCOLA MUNICIPAL PADRE ESTANISLAU CEBULA

NOME:

TURMA: DATA:

Atividades de matemática - Informática 1 - Profª Vanda

1-CONTINUE A SEQUÊNCIA, ARRASTANDO AS FIGURAS:

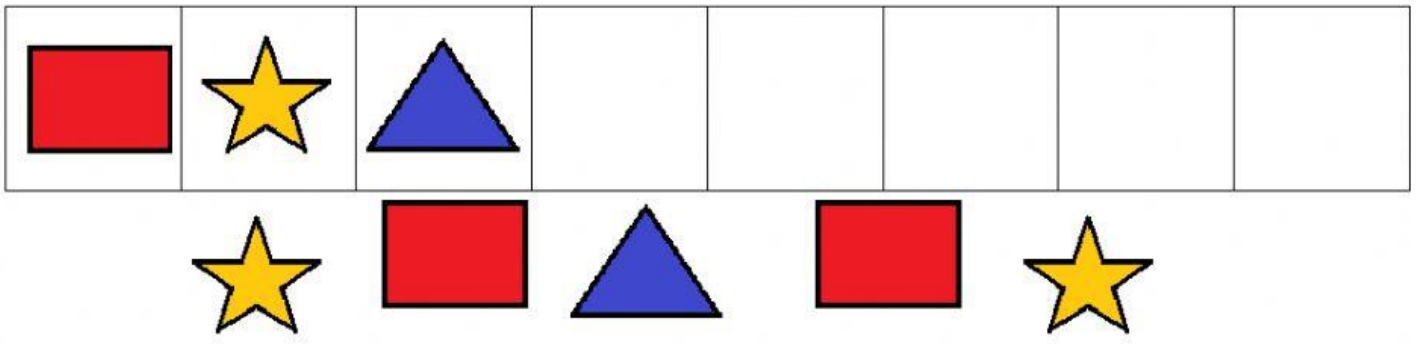



2-COMPLETE O CONJUNTO ATÉ FORMAR O NÚMERO QUE PEDE:

9



6