Fracciones impropias a números mixtos

1. Escribe la fracción impropia y el número mixto que corresponde a cada representación gráfica.

Representación gráfica	Fracción Impropia	Número Mixto
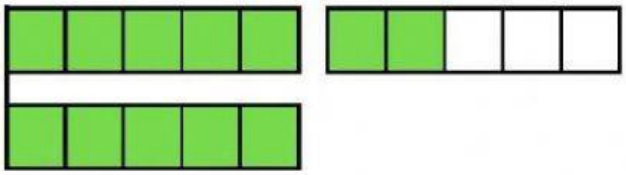	12 / 5	2 ; 2 / 5
		
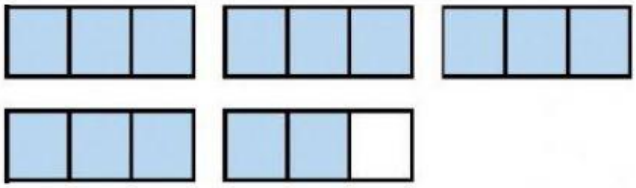		
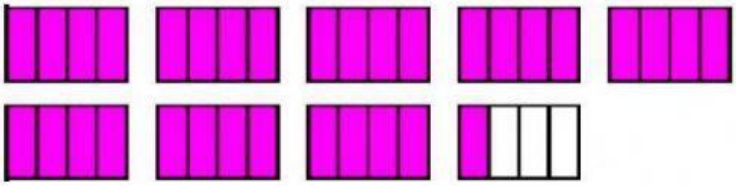		
		
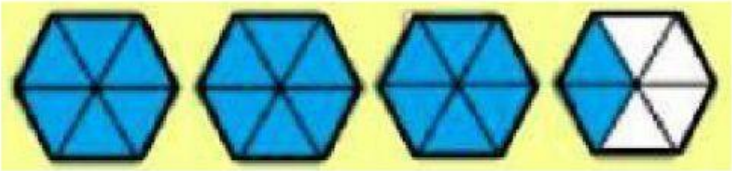		

LIVEWORKSHEETS
LIVEWORKSHEETS

		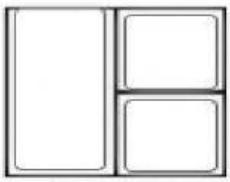

LIVEWORKSHEETS