Centro Educacional Thuty

Nome : _____

3 ° ano DATA: 31 / 05 / 2021

1- Observe cada figura abaixo e complete com atenção:

a) 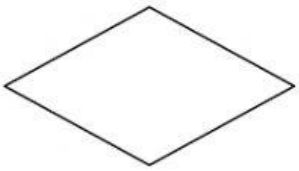

. número de lados : _____

. nome da figura: _____

b)

. número de lados : _____

. nome da figura: _____

c) 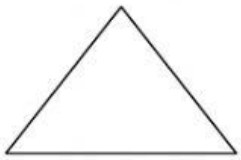

. número de lados: _____

. nome da figura: _____

d)

. número de lados : _____

. nome da figura: _____

2- Escreva o nome de cada sólido geométrico abaixo:

a) 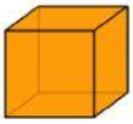 _____

b) _____

c) _____

d) 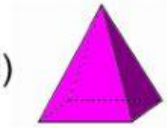 _____

e) _____

f)  _____

LIVEWORKSHEETS