Name: _____

Mathematics

1. Arrange from the **largest** to the **smallest**.

243, 234, 343, 432

_____ _____ _____ _____

2. Write in the missing numbers

367= (3×100) + (6 × _____) + (_____ × 1)

3. Paul made a design with 7 groups of 4 marbles. How many marbles did he use?

Answer: _____

4. Calculate the **Area** of the rectangle.



Answer: _____

5. A teacher has **27 markers**. She wants to give **each student 3 markers**. How many student will get markers?

Answer: _____

LIVEWORKSHEETS

6. Write how many **sides** there are in each shape.



_____ _____ _____

7. Select the coins to make up **20 cents**.

8. What is the fraction of the shape shaded?

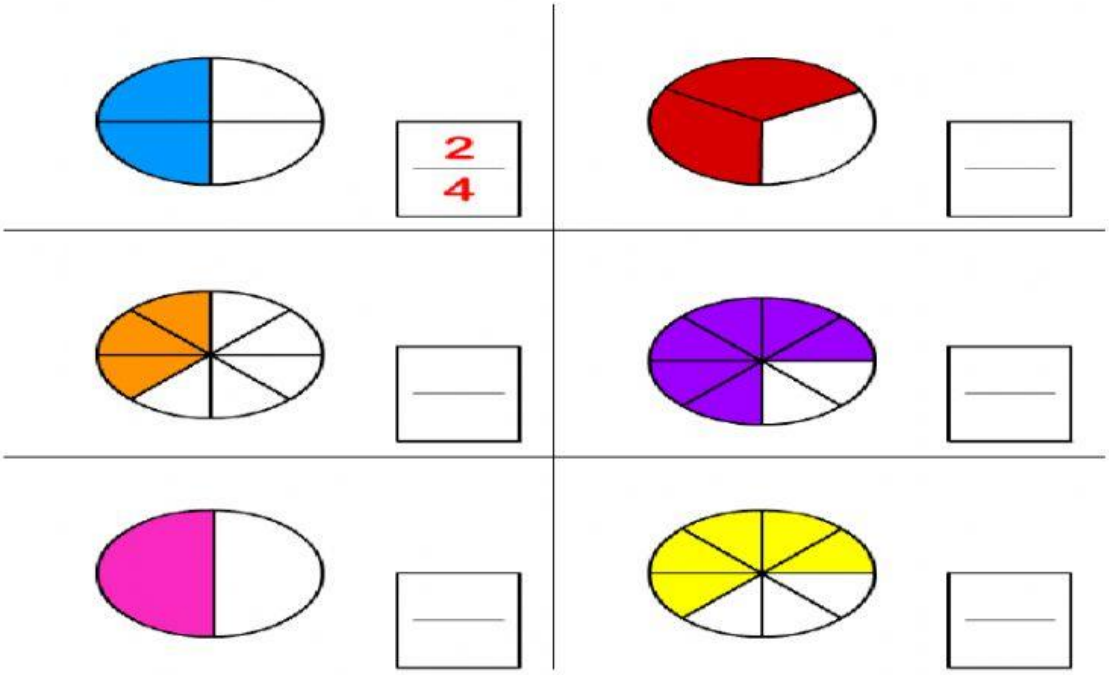

LIVEWORKSHEETS

9. What is the perimeter the square below, if one side is 5cm?

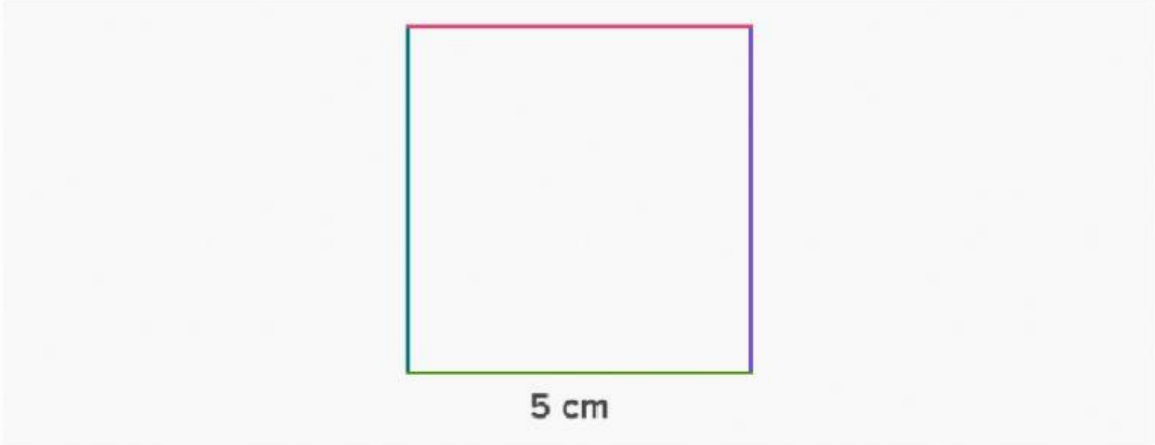

Answer: _____

10. There are 200 men at a meeting. 140 ladies join the meeting. Now there are _____ people at the meeting.

Answer: _____

LIVEWORKSHEETS