SOALAN SUBJEKTIF

Jawab **semua** soalan.
Answer **all** *questions.*

1 Bagi setiap graf yang berikut, nyatakan set yang berikut.
For each of the following graphs, state the following sets.

(i) V = Set bucu
V = *Set of vertices*

(ii) E = Set tepi
E = *Set of edges*

(a)

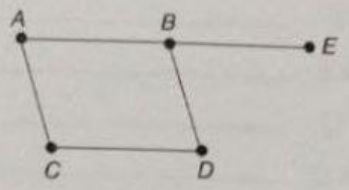

(b)

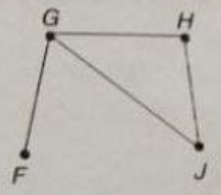

(c)

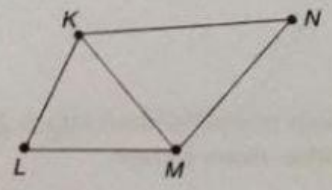

(d)

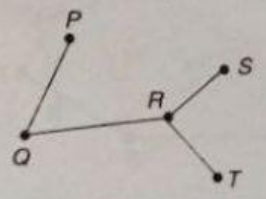

2 Rajah di bawah menunjukkan suatu graf.
The diagram below shows a graph.

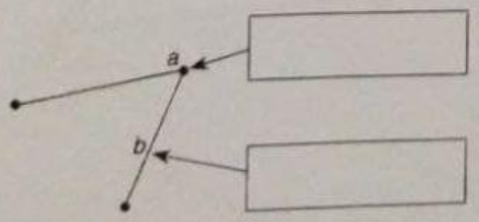

Namakan bahagian (a) dan (b).
Name the parts (a) and (b).

3 Bagi setiap graf yang berikut, lengkapkan jadual di bawah.
For each of the following graphs, complete the table below.

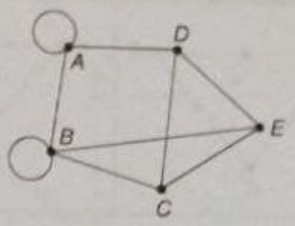

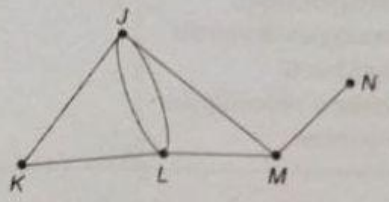

Bucu *Vertex*	Darjah bagi bucu *Degree of vertex*	Jumlah tepi *Total number of edges*
A		
B		
C		
D		
E		
J		
K		
L		
M		
N		

LIVEWORKSHEETS