Mathematics Practice before PAT

Bismillahirrahmanirrahiim

Answer the questions below.

Look at the picture below to answer number 1 and 2.

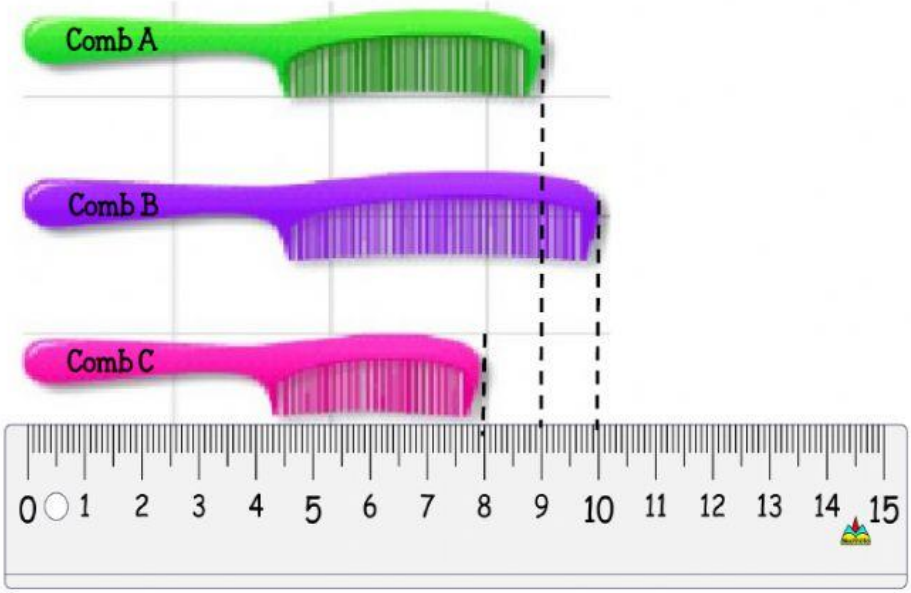

1. a) The length of comb A is _____ cm.

   b) The length of comb C is _____ cm.

   c) The length of comb ____ is 10 cm.

2. a) The longest item is the comb _____.

   b) The shortest item is the comb _____.

   c) The comb A is _____ cm shorter than comb B.

   d) The comb B is _____ cm longer than comb C.

3. Complete the sentences with the correct word based on the pictures.

   a)

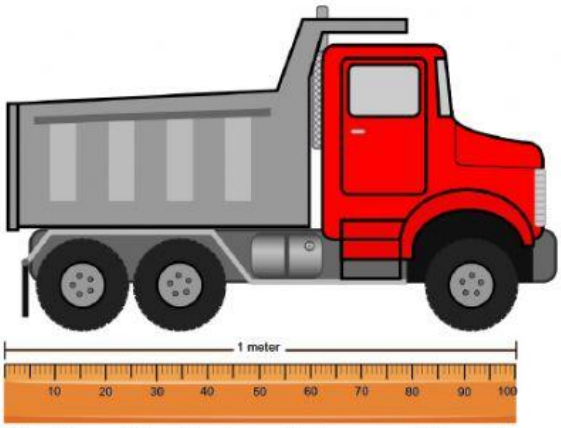

The length of a truck is _____ than 1 metre.

LIVEWORKSHEETS

b)

The height of a cactus plant is _____ than 1 metre.

c)



The length of a window is _____ than 1 metre.

What are the missing numbers?

4.

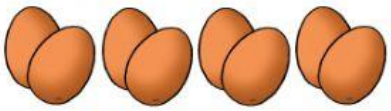

4 groups of ☐

2 + 2 + 2 + 2 = ☐

4 × 2 = ☐

5.

5 groups of 3

☐ + ☐ + ☐ + ☐ + ☐ = ☐

☐ threes = ☐

LIVEWORKSHEETS

6. Write the multiplication sentences.

a)

b)

☐ ○ ☐ = ☐

☐ ○ ☐ = ☐

Complete the missing numbers.

7.

There are 3 groups of sweets. Each group has 5 sweets.

How many sweets altogether?

Count in fives: ☐ ☐ ☐

3 × 5 = ☐

There are _____ sweets altogether.

8.

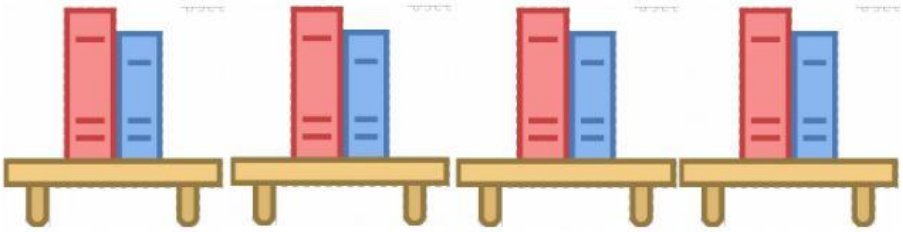

There are 2 books on the shelf.

How many books on 4 shelves?

Count in twos: ☐ ☐ ☐ ☐

4 × 2 = ☐

There are _____ books altogether.

LIVEWORKSHEETS

9. Complete.

a. $5 \times 5 =$ ☐

b. $2 \times 8 =$ ☐

c. $10 \times 9 =$ ☐

d. $5 \times 7 =$ ☐

10. Type the missing numbers.

a) Rahma drinks 2 glasses of milk in a day.

How many glasses does Rahma drink milk in 6 days?

☐ X ☐ = ☐

She drinks ☐ glasses of milk in 6 days.

b)



Ali finds 5 beautiful flowers in the garden. Each flower has 5 petals.

How many petals do 5 flowers have?

☐ X ☐ = ☐

There are ☐ petals in 5 flowers.

Alhamdulillaahirobbil 'aalamiin

LIVEWORKSHEETS