Name: _____

Mrs J's Resource Creations©

Metric Units

VOLUME (L X W X H)- CLUE 4

N.B: measurements are not to scale.

Reveal a clue by measuring the volume of the cubes and rectangular prisms below. Apply the formula **Volume = L X W X H.** Use your answers to match and place the letters in the boxes to reveal a clue. Put the letter in every box that it matches your answer in (there may be more than one!) ***The first one has been done for you.***

Click here to return to the Possible Locations Page

11	80	240	15	88	60	240	32	18	240	88	15

O											
10	32	10	100	8	72	18					

7	240	6	88	2	240	80	27	72	88	63	6	60

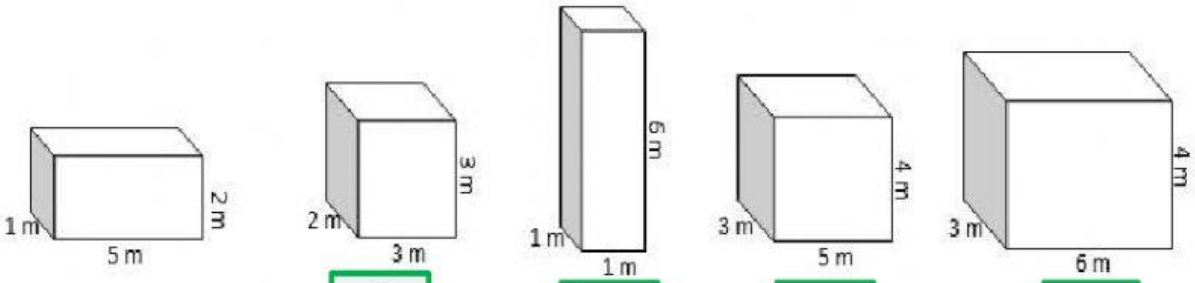

Volume = 10 m^3 **O**

V = ? m^3 **R**

V = ? m^3 **G**

V = ? m^3 **S**

V = ? m^3 **E**

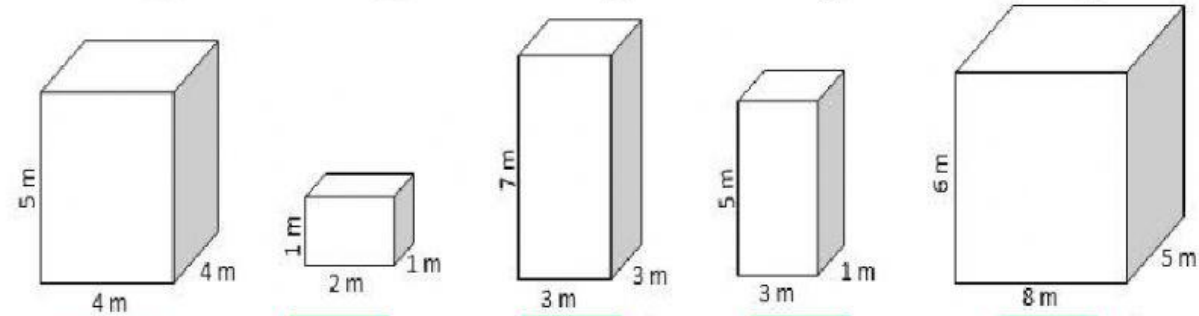

V = ? m^3 **L**

V = ? m^3 **C**

V = ? m^3 **N**

V = ? m^3 **D**

V = ? m^3 **A**

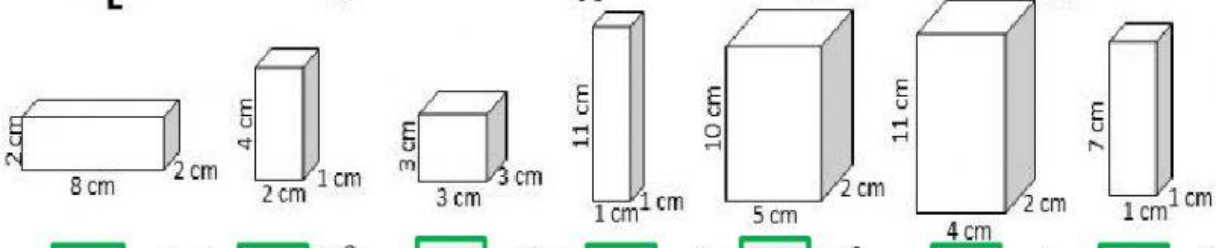

V = ? cm^3 **F**

V = ? m^3 **H**

V = ? m^3 **B**

V = ? m^3 **V**

V = ? cm^3 **T**

V = ? cm^3 **I**

V = ? m^3 **M**

LIVEWORKSHEETS