# FRACTION AND DECIMAL

1. Match the image to the correct decimal. (drag and drop)

A. 

B. 

C. 

D. 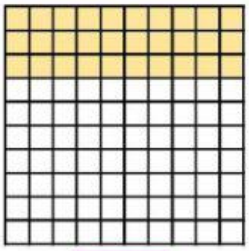

1. 0.7

2. 0.3

3. 0.2

There is one image that has no match.

VF
HW/Ext

2. Complete the missing values in the table based on the image.

| | |
|---|---|
| Fraction | $\frac{\square}{100}$ |
| Decimal | $0.\square$ |



VF
HW/Ext

3. Dua is thinking of a decimal between $\frac{3}{10}$ and $\frac{9}{10}$.

Demi says,

I think Dua's decimal is 0.7

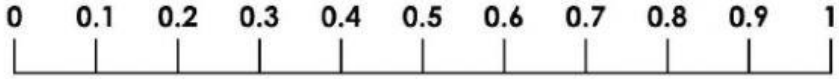


Is Demi correct?

RPS
HW/Ext



LIVEWORKSHEETS

# FRACTION AND DECIMAL

**4. Match the image to the correct decimal. (drag and drop)**

A.



B.

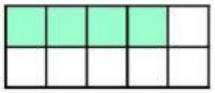

C.

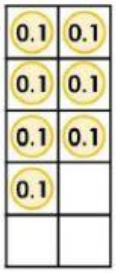


D.

1. 0.6
2. 0.3
3. 0.4

There is one image that has no match.

VF
HW/Ext

**5. Complete the missing values in the table.**

| | |
|---|---|
| Fraction | $\frac{\square}{\square}$ |
| Decimal | $\square . \square$ |



VF
HW/Ext

**6. Jon is thinking of a decimal between $\frac{1}{10}$ and $\frac{6}{10}$.**

Megan says,

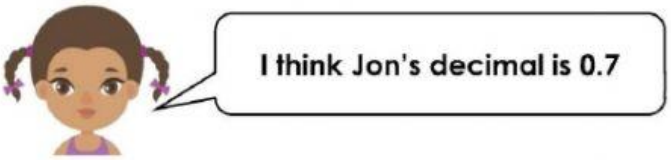


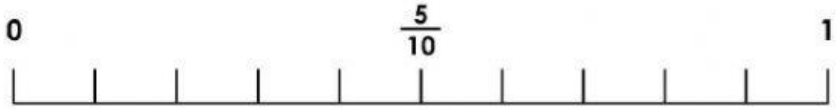


Is Megan correct?

RPS
HW/Ext



LIVEWORKSHEETS

# FRACTION AND DECIMAL

7. Match the representation to the correct decimal. (drag and drop)

A.



B.

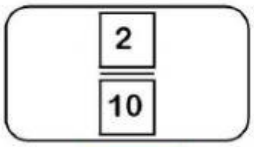


C.

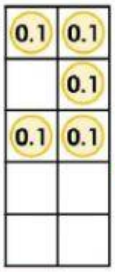


1. 0.7

2. 0.2

3. 0.5

VF
HW/Ext

8. Complete the missing values in the table.

| | |
|---|---|
| Fraction | $\frac{\square}{5}$ or $\frac{\square}{10}$ |
| Decimal | $\square.6$ |

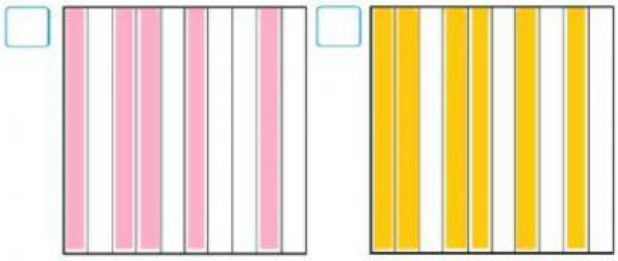

VF
HW/Ext

9. Peter is thinking of a decimal between $\frac{2}{10}$ and $\frac{8}{10}$.

Jayden says,



Is Jayden correct?

RPS
HW/Ext



LIVEWORKSHEETS